Encontrar los ángulos en las figuras Nombre:

**Cuenta el número de ángulos Agudos, Obtusos y Rectos dentro de cada figura**

**Ej)**

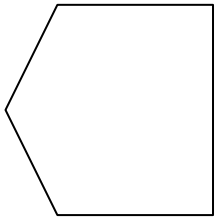

**1)**

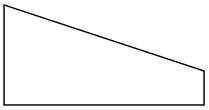

**2)**

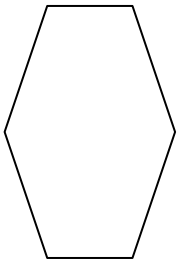

**3)**

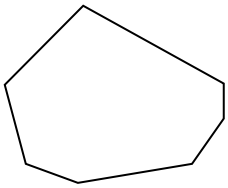

**4)**



**5)**

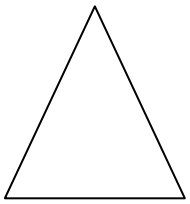

**6)**

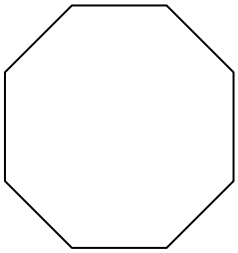

**7)**

**8)**

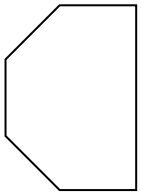

**9)**

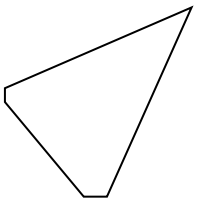

**10)**



**11)**

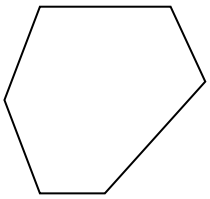

## Respuestas

| | | | |
|---|---|---|---|
| Ej. | 0 | 3 | 2 |
| 1. | | | |
| 2. | | | |
| 3. | | | |
| 4. | | | |
| 5. | | | |
| 6. | | | |
| 7. | | | |
| 8. | | | |
| 9. | | | |
| 10. | | | |
| 11. | | | |



| | | | | | | | | | | |
|---|---|---|---|---|---|---|---|---|---|---|
| 1-10 | 91 | 82 | 73 | 64 | 55 | 45 | 36 | 27 | 18 | 9 |
| 11 | 0 | | | | | | | | | |

Encontrar los ángulos en las figuras

Nombre: **Clave De Respuestas**

**Cuenta el número de ángulos Agudos, Obtusos y Rectos dentro de cada figura**

**Ej)**

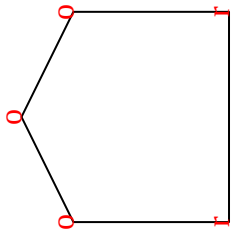

**1)**

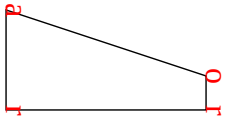

**2)**

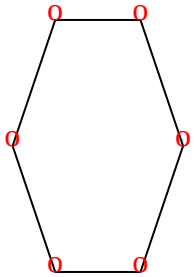

**3)**

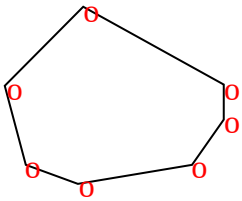

**4)**

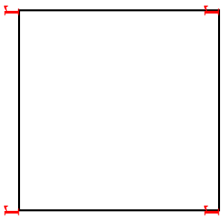

**5)**

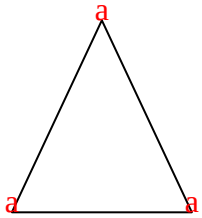

**6)**

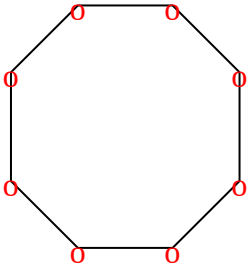

**7)**

**8)**

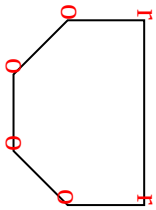

**9)**

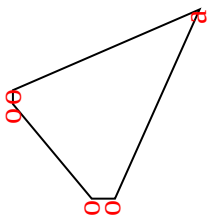

**10)**

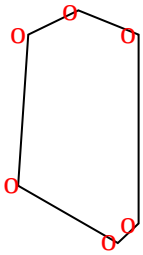

**11)**

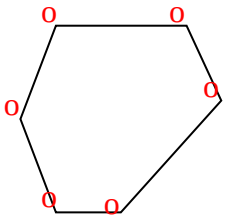

## Respuestas

| | | | |
|---|---|---|---|
| Ej. | 0 | 3 | 2 |
| 1. | 1 | 1 | 2 |
| 2. | 0 | 6 | 0 |
| 3. | 0 | 7 | 0 |
| 4. | 0 | 0 | 4 |
| 5. | 3 | 0 | 0 |
| 6. | 0 | 8 | 0 |
| 7. | 0 | 0 | 4 |
| 8. | 0 | 4 | 2 |
| 9. | 1 | 4 | 0 |
| 10. | 0 | 6 | 0 |
| 11. | 0 | 6 | 0 |



| | | | | | | | | | | |
|---|---|---|---|---|---|---|---|---|---|---|
| 1-10 | 91 | 82 | 73 | 64 | 55 | 45 | 36 | 27 | 18 | 9 |
| 11 | 0 | | | | | | | | | |