Completar y emparejar ecuaciones de volumen Nombre:

Empareje cada problema con la ecuación que podría representarlo. Responda con el término y la letra que faltan.

Ej) 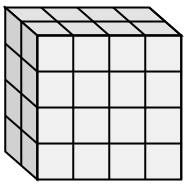

1) 

2) 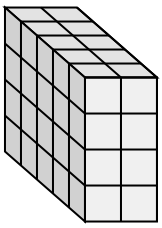

3) 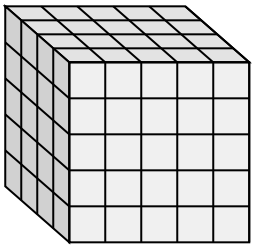

4) 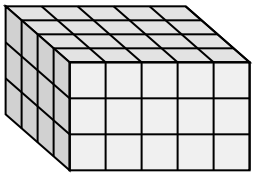

5) 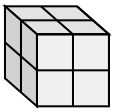

6) 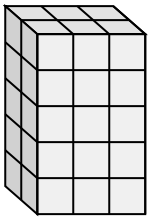

7) 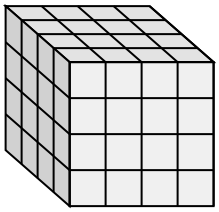

8) 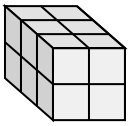

9) 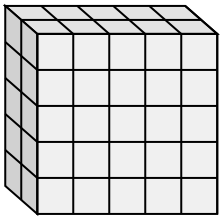

10) 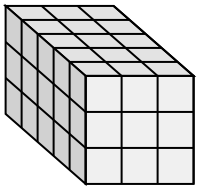

11) 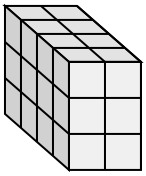

A. 4 × 5 × 3 = ___

B. 4 × ___ × 3 = 24

C. 2 × 3 × 5 = ___

D. ___ × 2 × 2 = 12

E. ___ × 5 × 5 = 50

F. ___ × 3 × 3 = 45

G. 5 × ___ × 4 = 40

H. 5 × 3 × 5 = ___

I. 4 × ___ × 4 = 64

J. 2 × ___ × 4 = 32

K. 4 × ___ × 5 = 100

L. 2 × ___ × 2 = 8

Respuestas

Ej. J , 4

1. _____

2. _____

3. _____

4. _____

5. _____

6. _____

7. _____

8. _____

9. _____

10. _____

11. _____

1-10	91	82	73	64	55	45	36	27	18	9
11	0									

Empareje cada problema con la ecuación que podría representarlo. Responda con el término y la letra que faltan.

Ej) 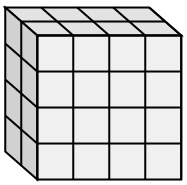

1) 

2) 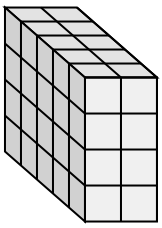

3) 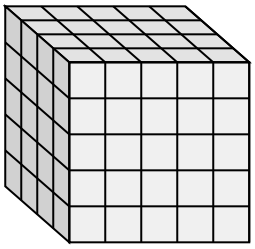

4) 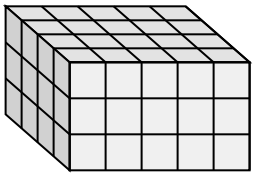

5) 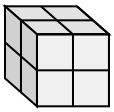

6) 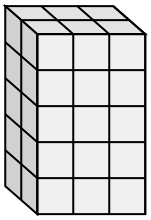

7) 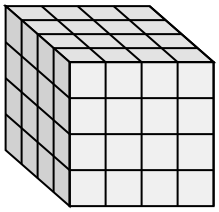

8) 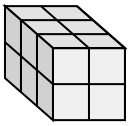

9) 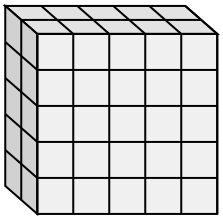

10) 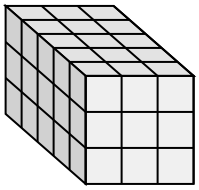

11) 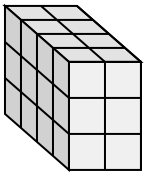

A. 4 × 5 × 3 = ___

B. 4 × ___ × 3 = 24

C. 2 × 3 × 5 = ___

D. ___ × 2 × 2 = 12

E. ___ × 5 × 5 = 50

F. ___ × 3 × 3 = 45

G. 5 × ___ × 4 = 40

H. 5 × 3 × 5 = ___

I. 4 × ___ × 4 = 64

J. 2 × ___ × 4 = 32

K. 4 × ___ × 5 = 100

L. 2 × ___ × 2 = 8

Respuestas

Ej. J , 4

1. H , 75
2. G , 2
3. K , 5
4. A , 60
5. L , 2
6. C , 30
7. I , 4
8. D , 3
9. E , 2
10. F , 5
11. B , 2

1-10	91	82	73	64	55	45	36	27	18	9
11	0									