Dividiendo con una recta numérica Nombre:

Usa las rectas numéricas para resolver los problemas.

1) 35÷7=

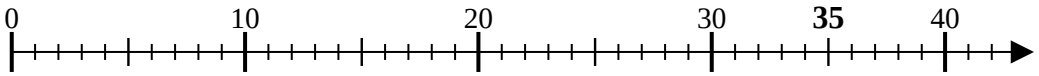

2) 21÷7=

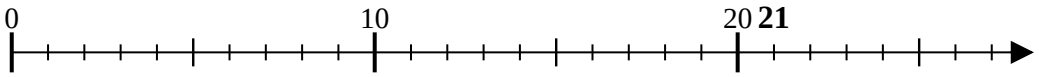

3) 12÷6=

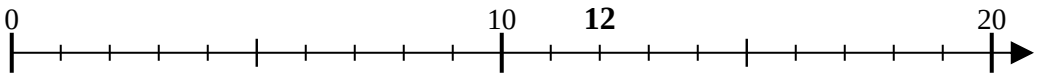

4) 6÷2=

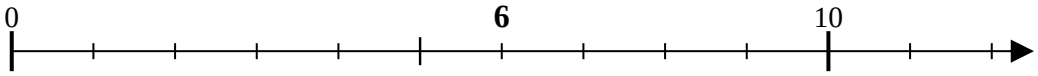

5) 28÷7=

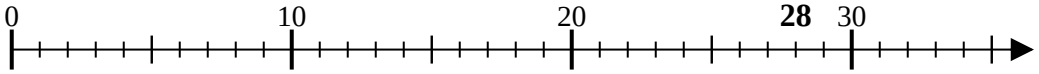

6) 10÷2=

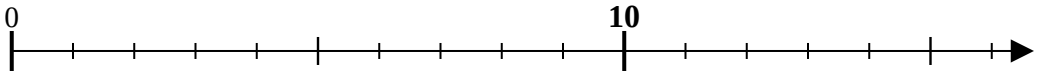

7) 9÷3=

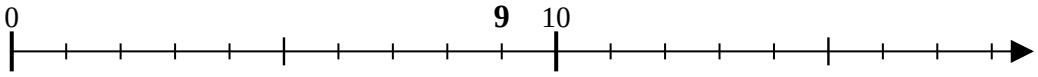

8) 18÷6=

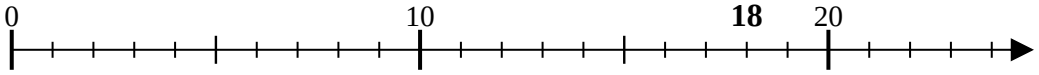

9) 10÷5=

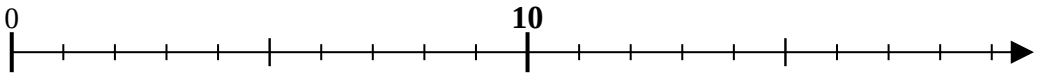

10) 18÷9=

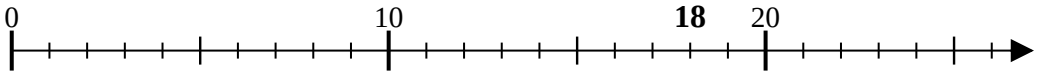

11) 24÷6=

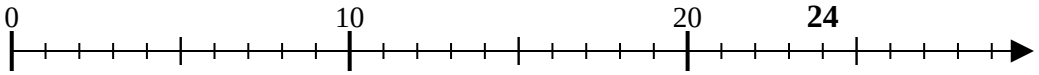

Respuestas

1. _____
2. _____
3. _____
4. _____
5. _____
6. _____
7. _____
8. _____
9. _____
10. _____
11. _____

1-10	91	82	73	64	55	45	36	27	18	9
11	0									

Usa las rectas numéricas para resolver los problemas.

1) 35÷7=

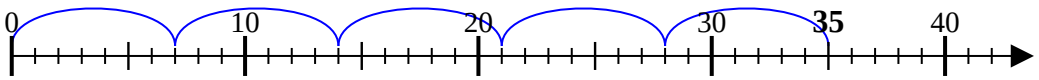

2) 21÷7=

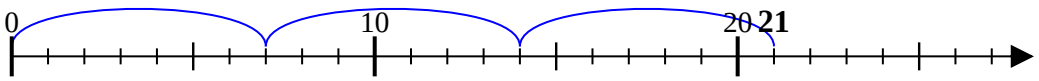

3) 12÷6=

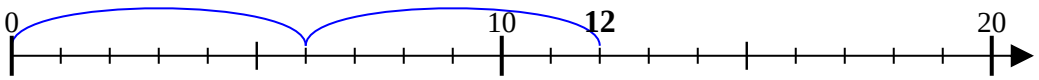

4) 6÷2=

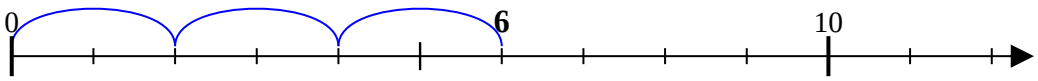

5) 28÷7=

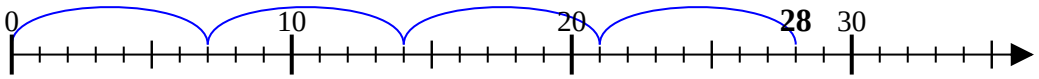

6) 10÷2=

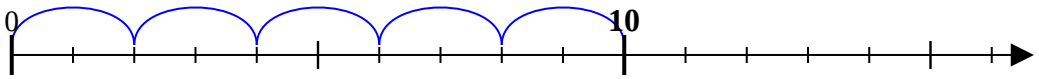

7) 9÷3=

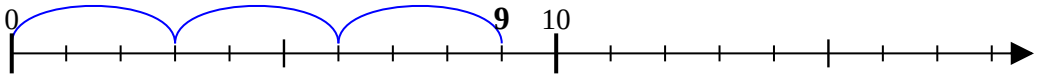

8) 18÷6=

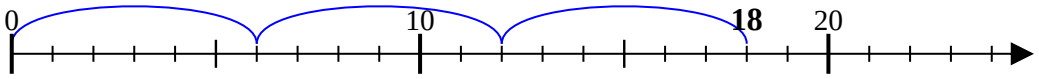

9) 10÷5=

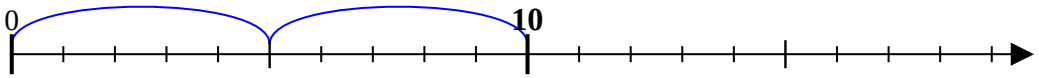

10) 18÷9=

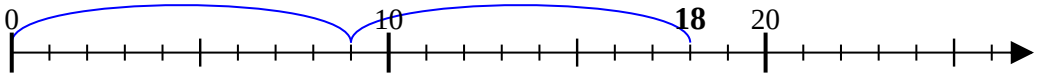

11) 24÷6=

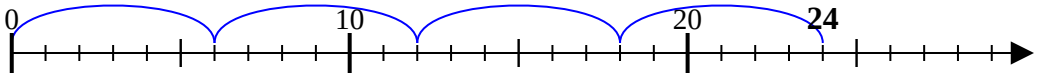

Respuestas

1. 5
2. 3
3. 2
4. 3
5. 4
6. 5
7. 3
8. 3
9. 2
10. 2
11. 4

1-10	91	82	73	64	55	45	36	27	18	9
11	0									