Dividiendo con una recta numérica Nombre:

Usa las rectas numéricas para resolver los problemas.

1) 12÷6=

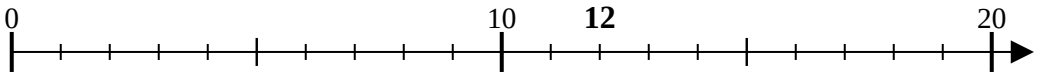

2) 50÷10=

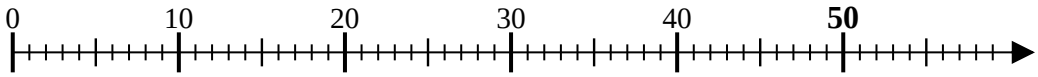

3) 6÷2=

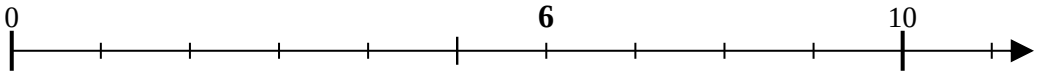

4) 10÷5=

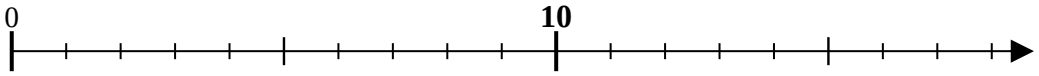

5) 16÷8=

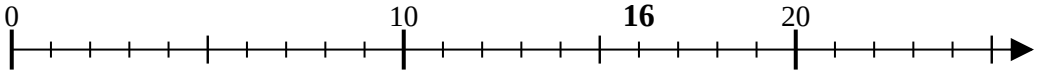

6) 8÷2=

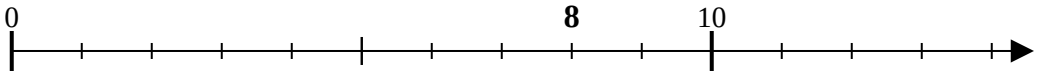

7) 35÷7=

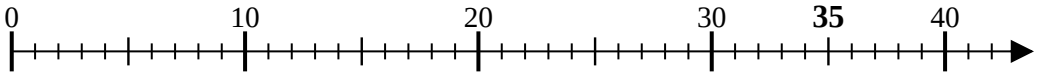

8) 40÷10=

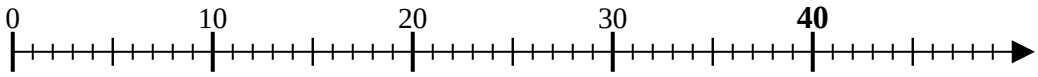

9) 18÷6=

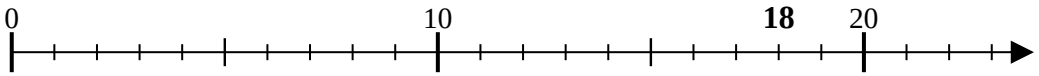

10) 25÷5=

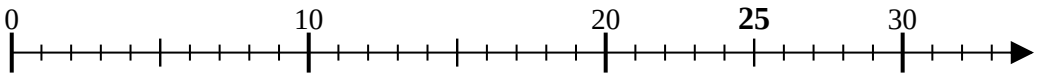

11) 30÷6=

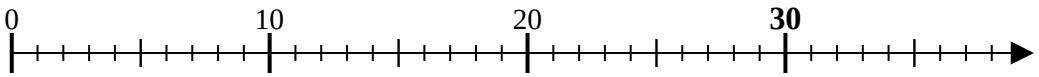

Respuestas

1. _____
2. _____
3. _____
4. _____
5. _____
6. _____
7. _____
8. _____
9. _____
10. _____
11. _____

1-10	91	82	73	64	55	45	36	27	18	9
11	0									

Usa las rectas numéricas para resolver los problemas.

1) 12÷6=

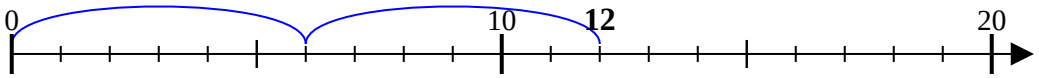

2) 50÷10=

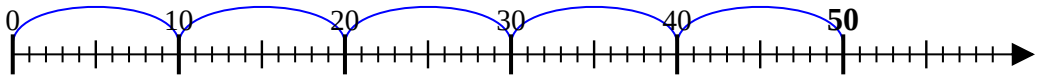

3) 6÷2=

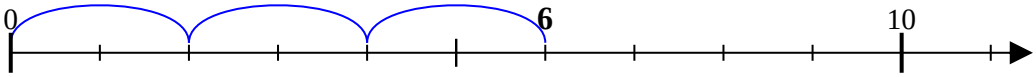

4) 10÷5=

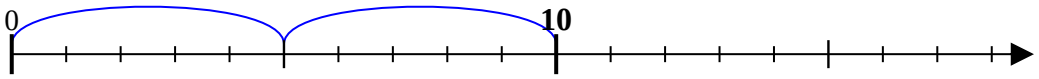

5) 16÷8=

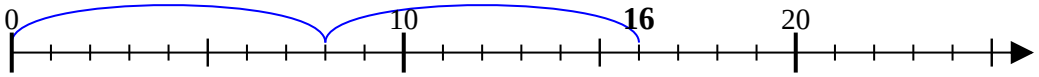

6) 8÷2=

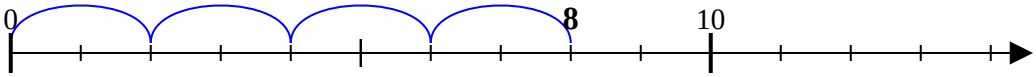

7) 35÷7=

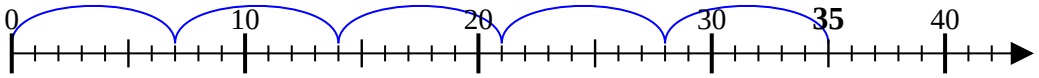

8) 40÷10=

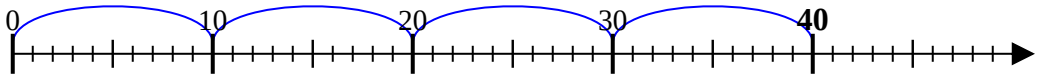

9) 18÷6=

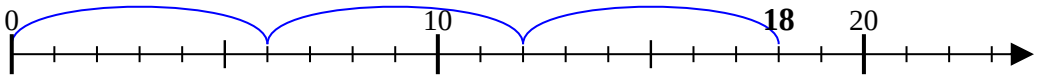

10) 25÷5=

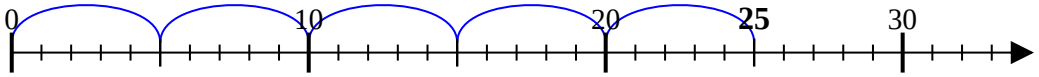

11) 30÷6=

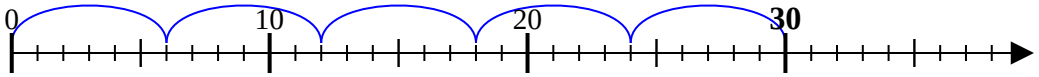

Respuestas

1. 2
2. 5
3. 3
4. 2
5. 2
6. 4
7. 5
8. 4
9. 3
10. 5
11. 5

1-10	91	82	73	64	55	45	36	27	18	9
11	0									