Dividiendo con una recta numérica

Nombre:

Usa las rectas numéricas para resolver los problemas.

1) 30÷10=

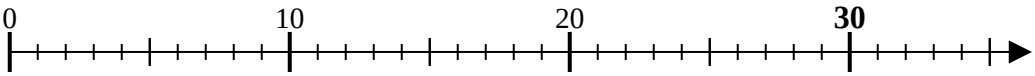

2) 32÷8=

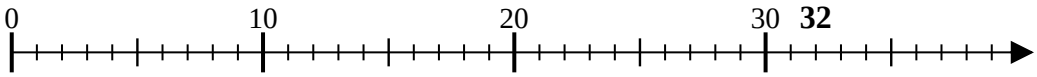

3) 21÷7=

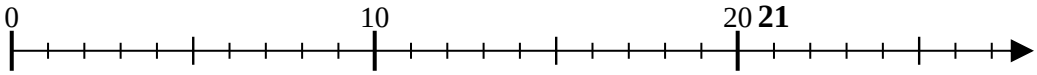

4) 18÷9=

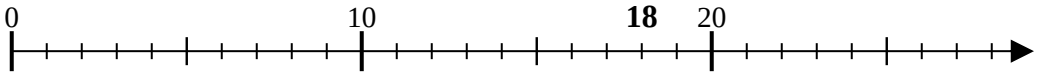

5) 20÷5=

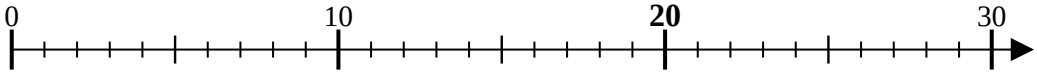

6) 12÷6=

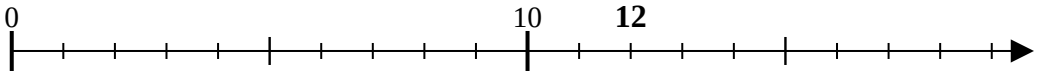

7) 15÷3=

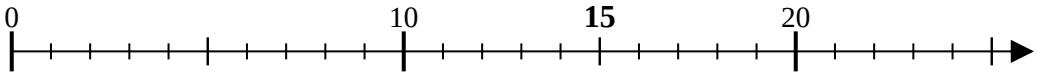

8) 18÷6=

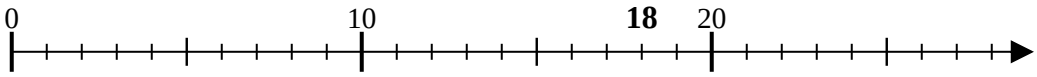

9) 12÷4=

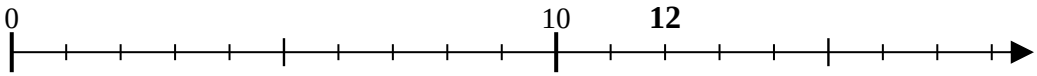

10) 27÷9=

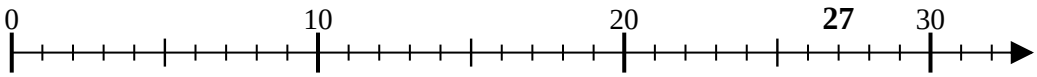

11) 14÷7=

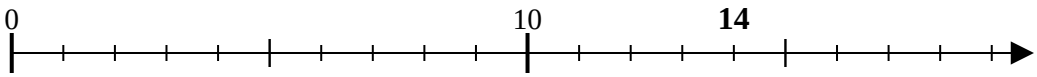

Respuestas

1. _____
2. _____
3. _____
4. _____
5. _____
6. _____
7. _____
8. _____
9. _____
10. _____
11. _____

1-10	91	82	73	64	55	45	36	27	18	9
11	0									

Dividiendo con una recta numérica

Nombre: **Clave De Respuestas**

Usa las rectas numéricas para resolver los problemas.

1) 30÷10=

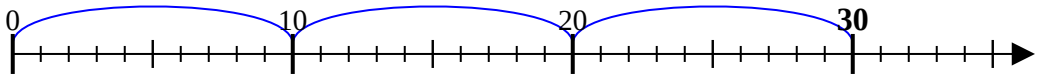

2) 32÷8=

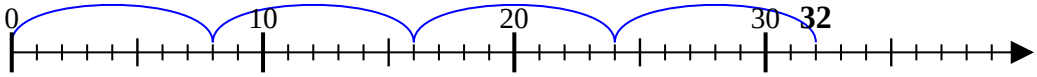

3) 21÷7=

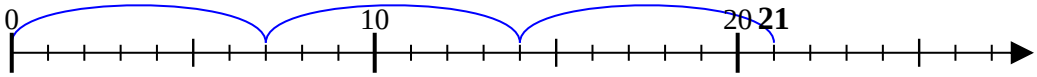

4) 18÷9=

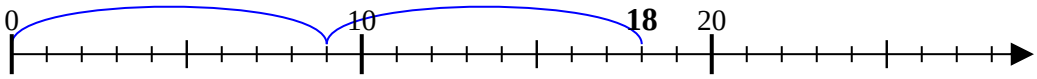

5) 20÷5=

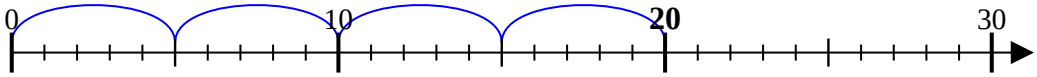

6) 12÷6=

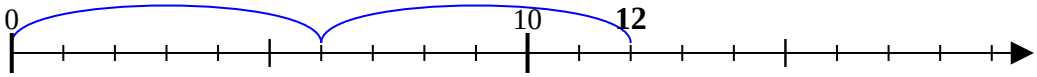

7) 15÷3=

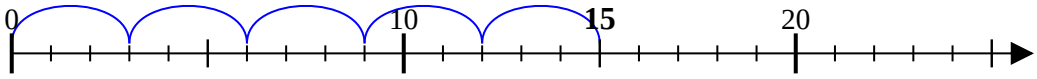

8) 18÷6=

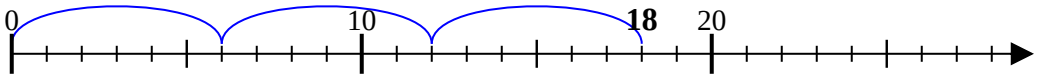

9) 12÷4=

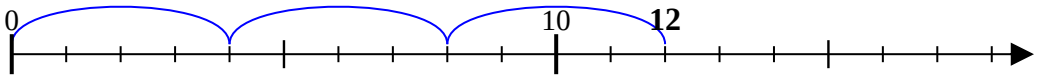

10) 27÷9=

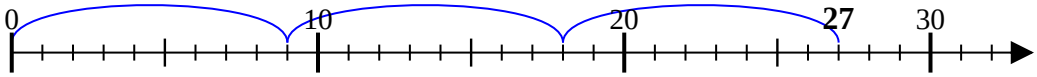

11) 14÷7=

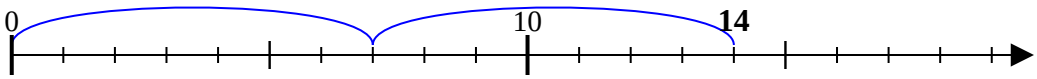

Respuestas

1. 3
2. 4
3. 3
4. 2
5. 4
6. 2
7. 5
8. 3
9. 3
10. 3
11. 2

1-10	91	82	73	64	55	45	36	27	18	9
11	0									