Fracción, Decimal y Porcentaje (Visual)

Nombre:

Determina el valor escrito como fracción, decimal y porcentaje.

Ej)



fracción $^{9}/_{10}$
décimal 0.9
porcentaje 90

1)

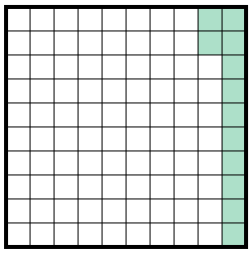

fracción _____
décimal _____
porcentaje _____

2)

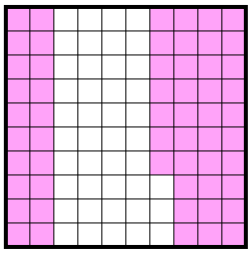

fracción _____
décimal _____
porcentaje _____

3)

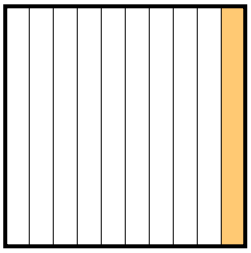

fracción _____
décimal _____
porcentaje _____

4)

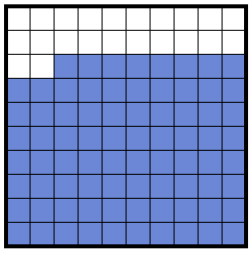

fracción _____
décimal _____
porcentaje _____

5)

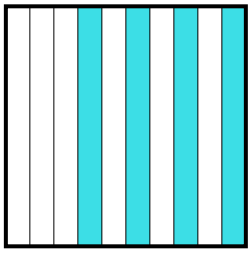

fracción _____
décimal _____
porcentaje _____

6)

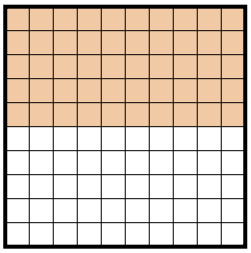

fracción _____
décimal _____
porcentaje _____

7)

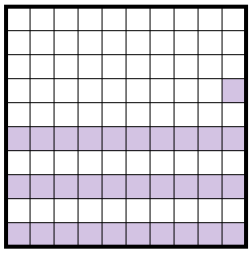

fracción _____
décimal _____
porcentaje _____

8)

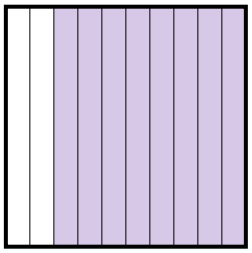

fracción _____
décimal _____
porcentaje _____

9)

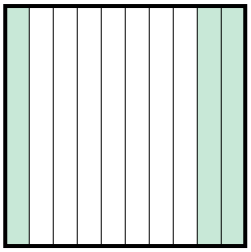

fracción _____
décimal _____
porcentaje _____

10)

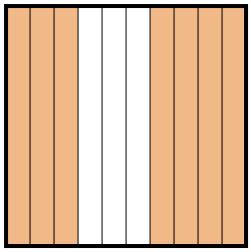

fracción _____
décimal _____
porcentaje _____

11)

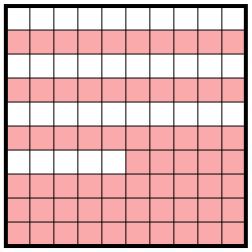

fracción _____
décimal _____
porcentaje _____

Respuestas

Ej.	$^{9}/_{10}$	0.9	90%
1.			
2.			
3.			
4.			
5.			
6.			
7.			
8.			
9.			
10.			
11.			

1-10	91	82	73	64	55	45	36	27	18	9
11	0									

Determina el valor escrito como fracción, decimal y porcentaje.

Ej)



fracción $^{9}/_{10}$
décimal 0.9
porcentaje 90

1)

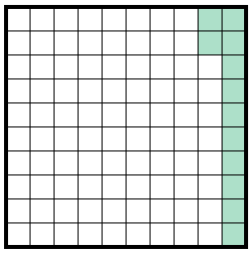

fracción $^{12}/_{100}$
décimal 0.12
porcentaje 12

2)

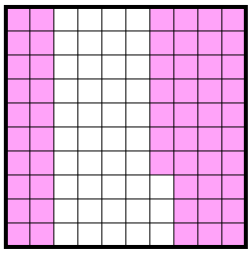

fracción $^{57}/_{100}$
décimal 0.57
porcentaje 57

3)

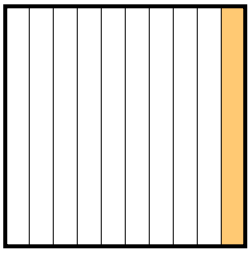

fracción $^{1}/_{10}$
décimal 0.1
porcentaje 10

4)

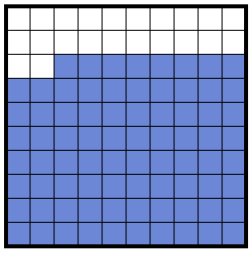

fracción $^{78}/_{100}$
décimal 0.78
porcentaje 78

5)

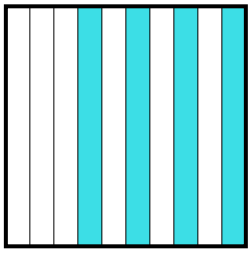

fracción $^{4}/_{10}$
décimal 0.4
porcentaje 40

6)

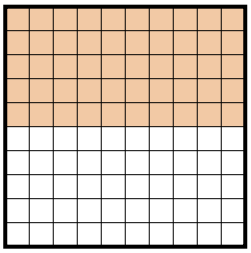

fracción $^{50}/_{100}$
décimal 0.50
porcentaje 50

7)

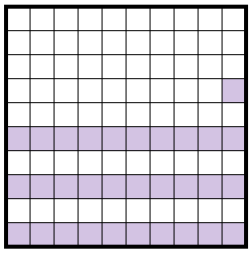

fracción $^{31}/_{100}$
décimal 0.31
porcentaje 31

8)

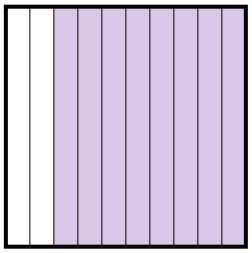

fracción $^{8}/_{10}$
décimal 0.8
porcentaje 80

9)

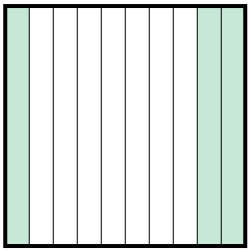

fracción $^{3}/_{10}$
décimal 0.3
porcentaje 30

10)

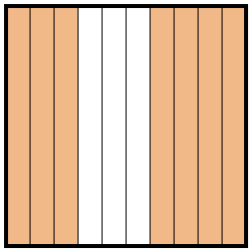

fracción $^{7}/_{10}$
décimal 0.7
porcentaje 70

11)

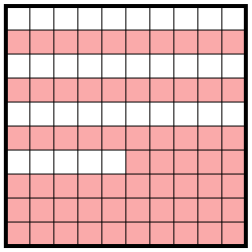

fracción $^{65}/_{100}$
décimal 0.65
porcentaje 65

Respuestas

Ej.	$^{9}/_{10}$	0.9	90%
1.	$^{12}/_{100}$	0.12	12%
2.	$^{57}/_{100}$	0.57	57%
3.	$^{1}/_{10}$	0.1	10%
4.	$^{78}/_{100}$	0.78	78%
5.	$^{4}/_{10}$	0.4	40%
6.	$^{50}/_{100}$	0.50	50%
7.	$^{31}/_{100}$	0.31	31%
8.	$^{8}/_{10}$	0.8	80%
9.	$^{3}/_{10}$	0.3	30%
10.	$^{7}/_{10}$	0.7	70%
11.	$^{65}/_{100}$	0.65	65%

1-10	91	82	73	64	55	45	36	27	18	9
11	0									