Multiplicando Fracciones (visualmente) Nombre:

Usa la caja para mostrar de manera visual cómo multiplicar dos fracciones.

Ej) $\frac{1}{2} \times \frac{5}{9} =$

1) $\frac{1}{5} \times \frac{1}{2} =$

2) $\frac{6}{7} \times \frac{4}{7} =$

3) $\frac{1}{6} \times \frac{1}{5} =$

4) $\frac{1}{3} \times \frac{2}{5} =$

5) $\frac{1}{2} \times \frac{1}{2} =$

6) $\frac{3}{5} \times \frac{2}{3} =$

7) $\frac{7}{9} \times \frac{2}{7} =$

8) $\frac{6}{9} \times \frac{4}{9} =$

9) $\frac{5}{8} \times \frac{3}{5} =$

10) $\frac{1}{2} \times \frac{3}{5} =$

11) $\frac{2}{8} \times \frac{1}{2} =$

Respuestas

Ej. $5/18$

1. _____
2. _____
3. _____
4. _____
5. _____
6. _____
7. _____
8. _____
9. _____
10. _____
11. _____

1-10	91	82	73	64	55	45	36	27	18	9
11	0									

Usa la caja para mostrar de manera visual cómo multiplicar dos fracciones.

Ej) $\frac{1}{2} \times \frac{5}{9} =$

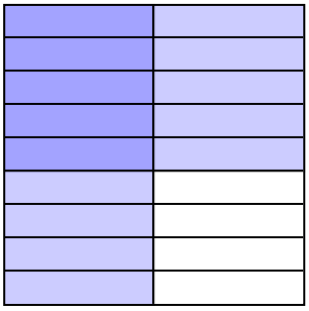

1) $\frac{1}{5} \times \frac{1}{2} =$

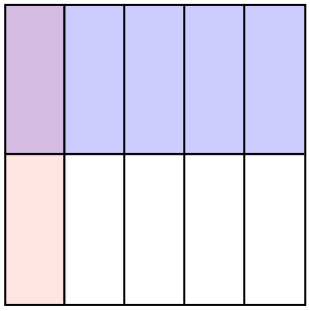

2) $\frac{6}{7} \times \frac{4}{7} =$

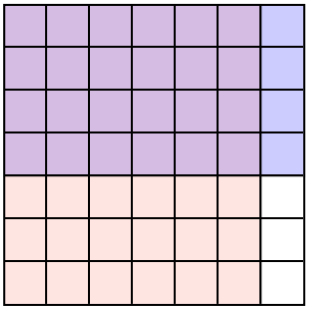

3) $\frac{1}{6} \times \frac{1}{5} =$

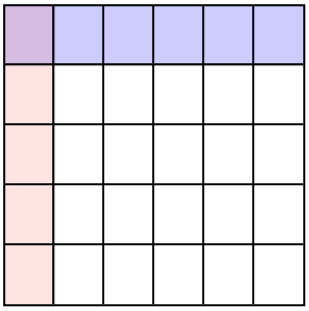

4) $\frac{1}{3} \times \frac{2}{5} =$

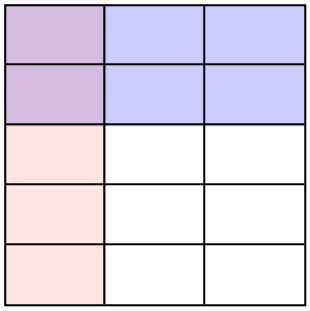

5) $\frac{1}{2} \times \frac{1}{2} =$



6) $\frac{3}{5} \times \frac{2}{3} =$

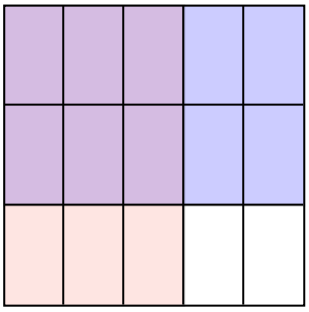

7) $\frac{7}{9} \times \frac{2}{7} =$

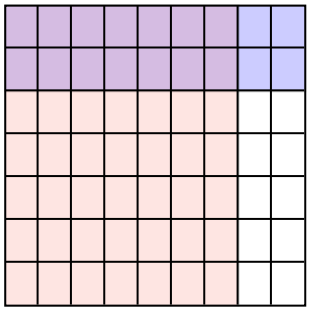

8) $\frac{6}{9} \times \frac{4}{9} =$

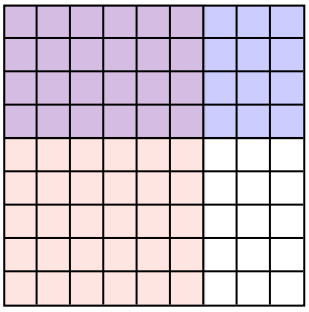

9) $\frac{5}{8} \times \frac{3}{5} =$

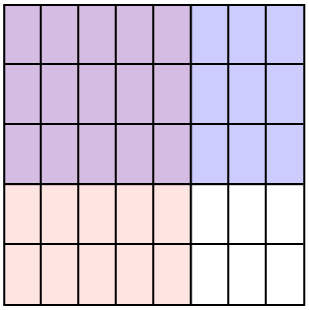

10) $\frac{1}{2} \times \frac{3}{5} =$



11) $\frac{2}{8} \times \frac{1}{2} =$

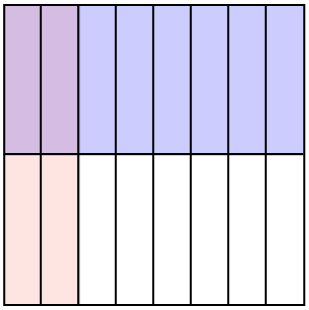

Respuestas

Ej.	5/18
1.	1/10
2.	24/49
3.	1/30
4.	2/15
5.	1/4
6.	6/15
7.	14/63
8.	24/81
9.	15/40
10.	3/10
11.	2/16

1-10	91	82	73	64	55	45	36	27	18	9
11	0									