Crear rectángulos en una cuadrícula con coordenadas Nombre:

Encuentra las coordenadas del punto D para hacer un rectángulo.

Ej)

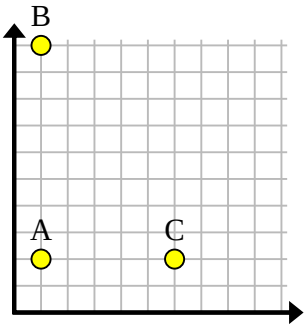

1)

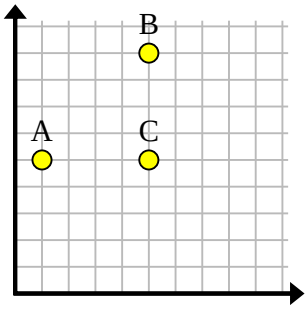

2)

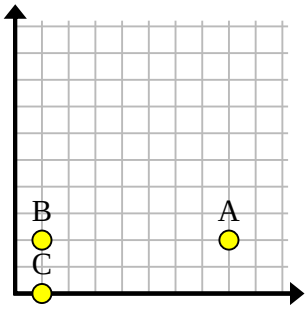

3)

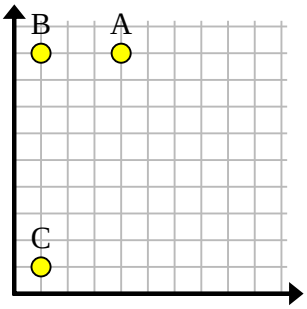

4)

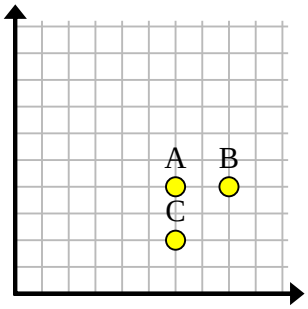

5)

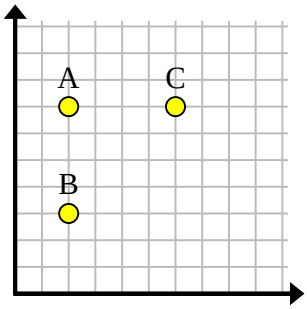

6)

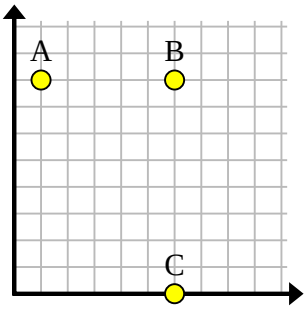

7)

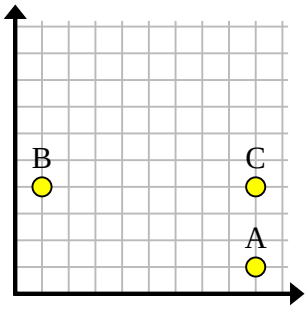

8)

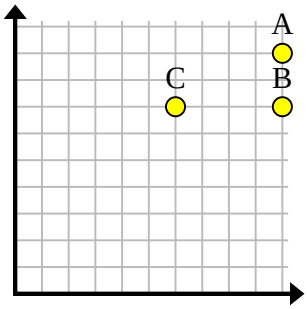

9)

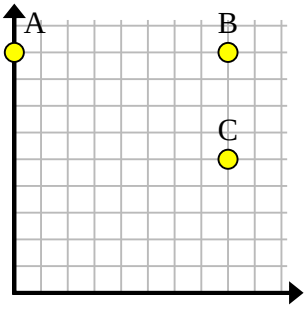

10)

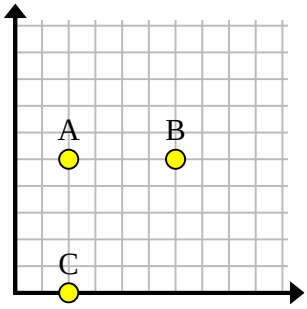

11)

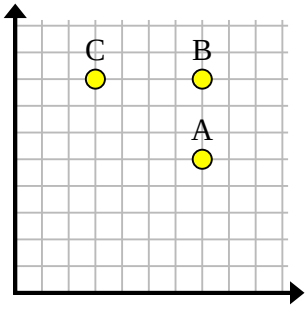

Respuestas

Ej. (6 , 10)

1. _____
2. _____
3. _____
4. _____
5. _____
6. _____
7. _____
8. _____
9. _____
10. _____
11. _____

1-10	91	82	73	64	55	45	36	27	18	9
11	0									

Crear rectángulos en una cuadrícula con coordenadas Nombre: **Clave De Respuestas**

Encuentra las coordenadas del punto D para hacer un rectángulo.

Ej)

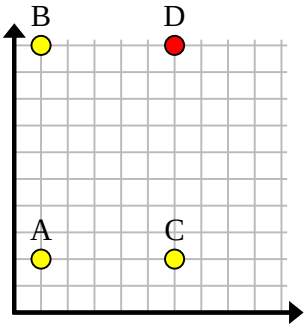

1)

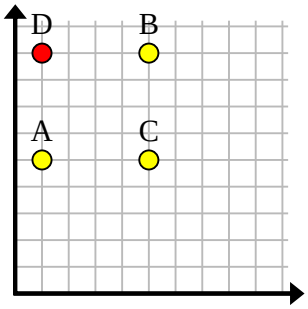

2)

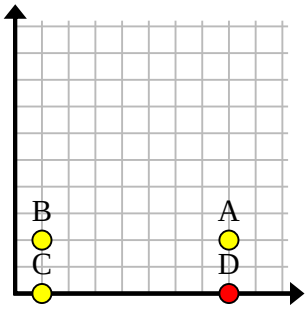

3)

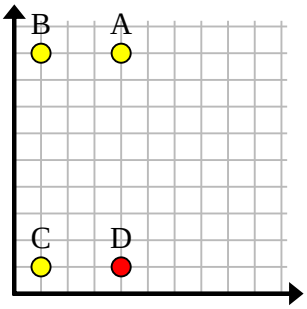

4)

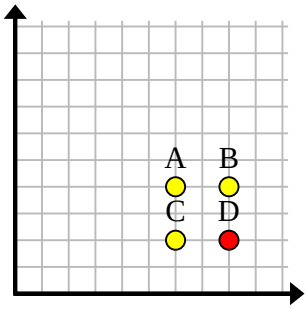

5)

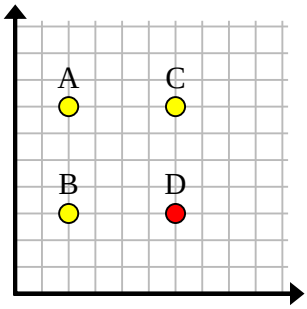

6)

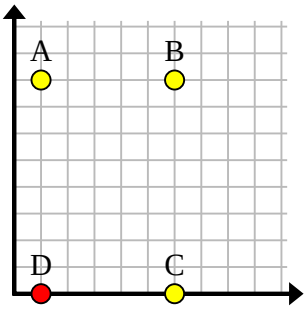

7)

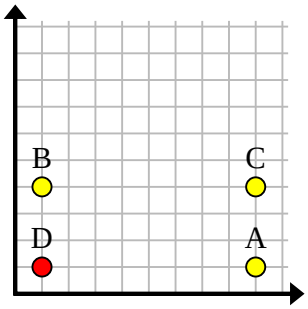

8)

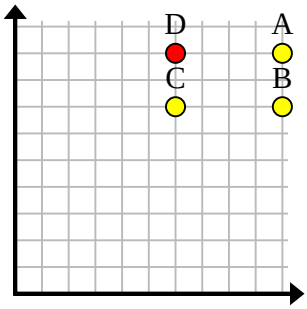

9)

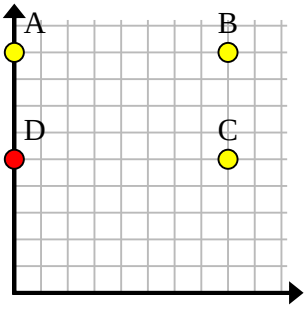

10)

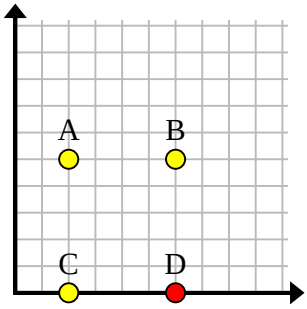

11)

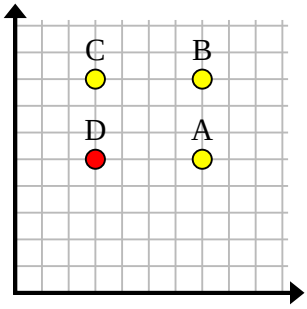

Respuestas

Ej.	(6 , 10)
1.	(1 , 9)
2.	(8 , 0)
3.	(4 , 1)
4.	(8 , 2)
5.	(6 , 3)
6.	(1 , 0)
7.	(1 , 1)
8.	(6 , 9)
9.	(0 , 5)
10.	(6 , 0)
11.	(3 , 5)

1-10	91	82	73	64	55	45	36	27	18	9
11	0									