Crear rectángulos en una cuadrícula con coordenadas Nombre:

Encuentra las coordenadas del punto D para hacer un rectángulo.

Ej)

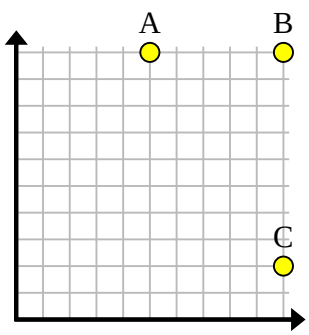

1)

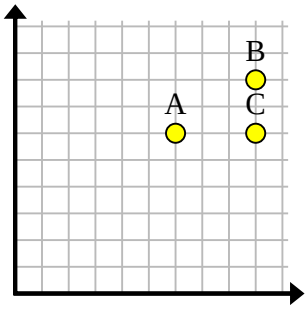

2)

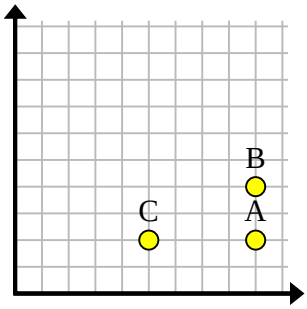

3)

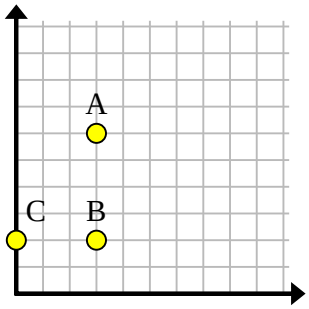

4)

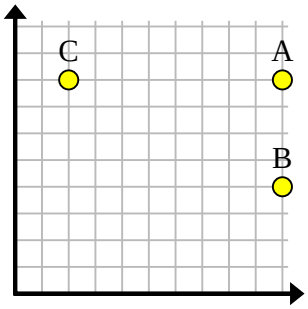

5)

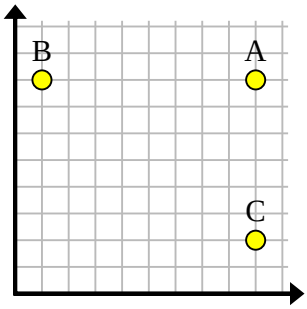

6)

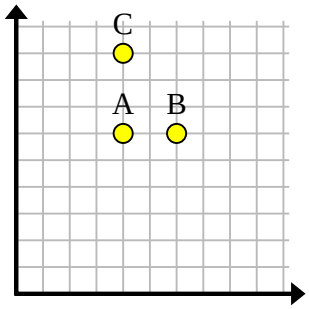

7)

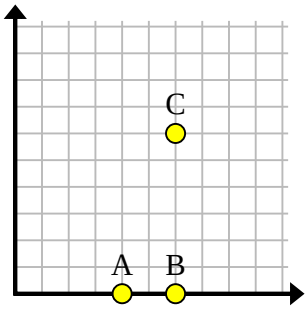

8)

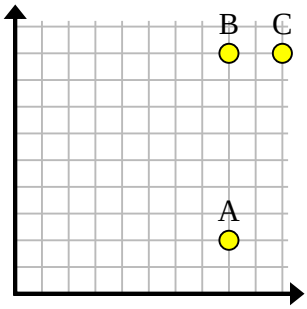

9)

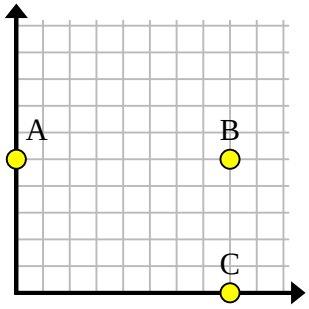

10)

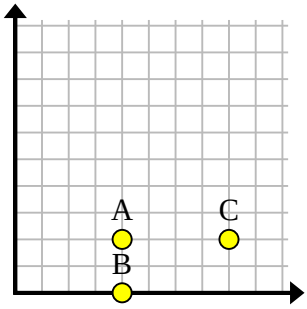

11)

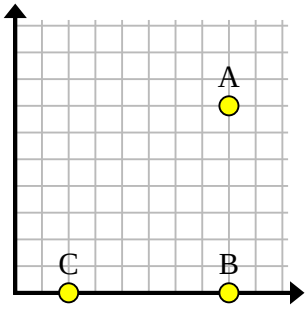

Respuestas

Ej. (5,2)

1. _____
2. _____
3. _____
4. _____
5. _____
6. _____
7. _____
8. _____
9. _____
10. _____
11. _____

1-10	91	82	73	64	55	45	36	27	18	9
11	0									

Crear rectángulos en una cuadrícula con coordenadas Nombre: **Clave De Respuestas**

Encuentra las coordenadas del punto D para hacer un rectángulo.

Ej)

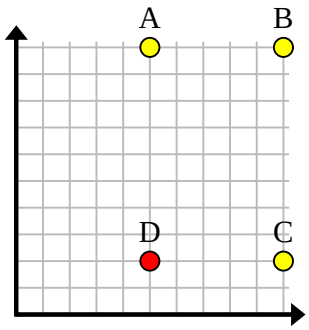

1)

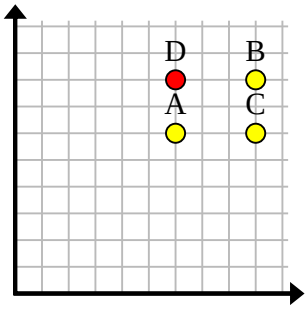

2)

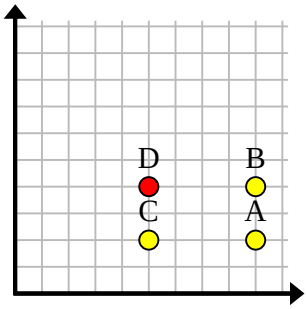

3)

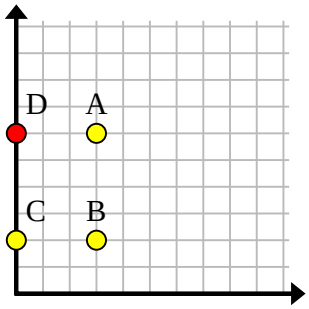

4)

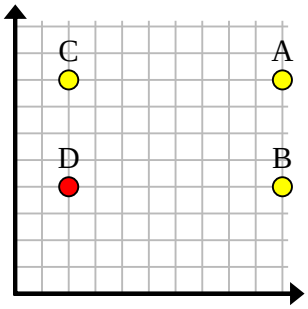

5)

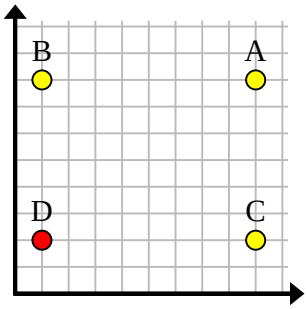

6)

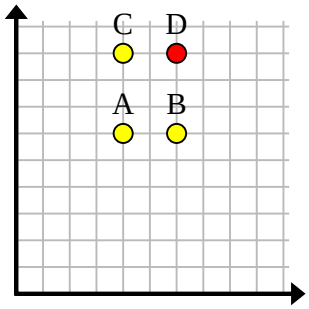

7)

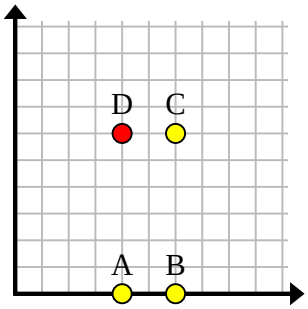

8)

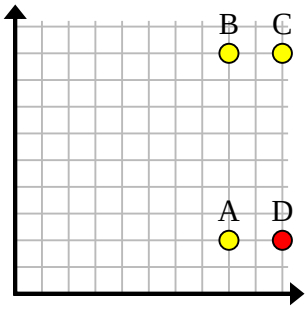

9)

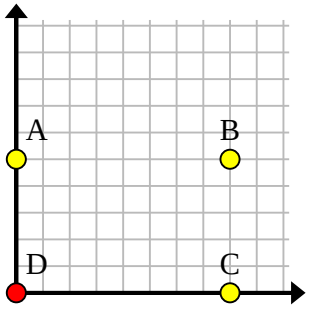

10)

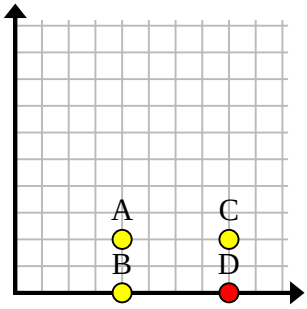

11)

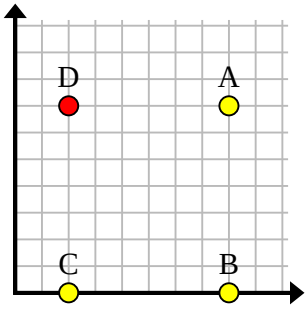

Respuestas

Ej.	(5, 2)
1.	(6, 8)
2.	(5, 4)
3.	(0, 6)
4.	(2, 4)
5.	(1, 2)
6.	(6, 9)
7.	(4, 6)
8.	(10, 2)
9.	(0, 0)
10.	(8, 0)
11.	(2, 7)

1-10	91	82	73	64	55	45	36	27	18	9
11	0									