Crear rectángulos en una cuadrícula con coordenadas Nombre:

**Encuentra las coordenadas del punto D para hacer un rectángulo.**

**Ej)**

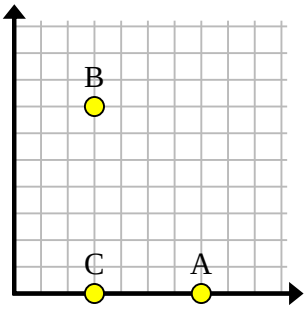


**1)**

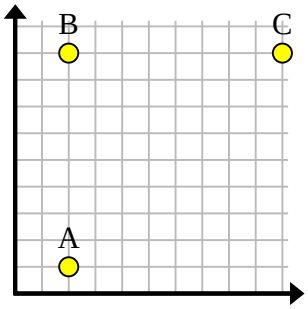


**2)**

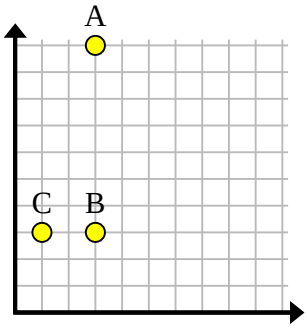


**3)**

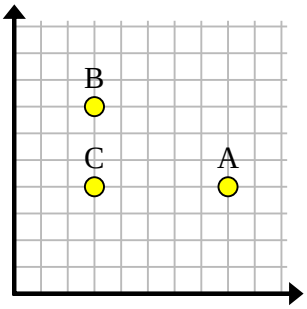


**4)**

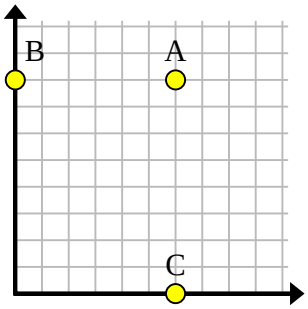


**5)**

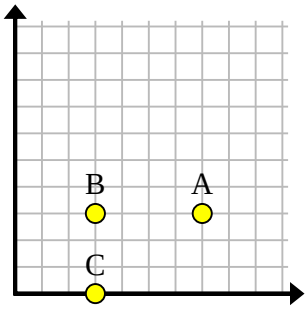


**6)**

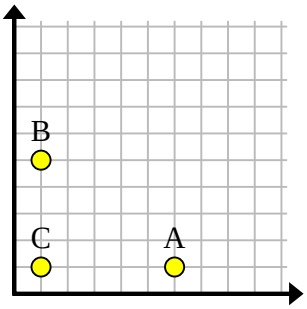


**7)**

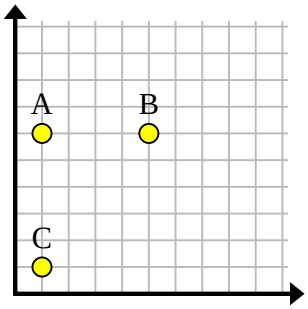


**8)**

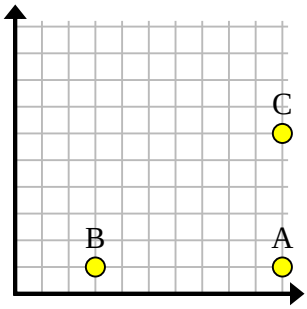


**9)**

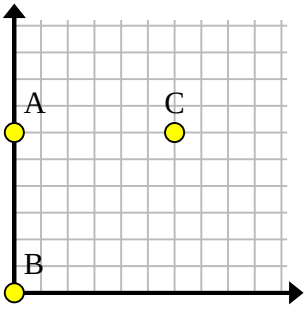


**10)**

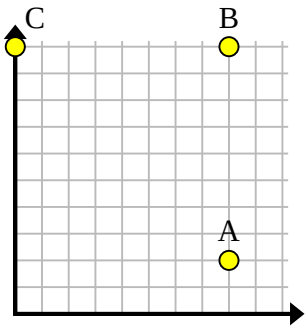


**11)**

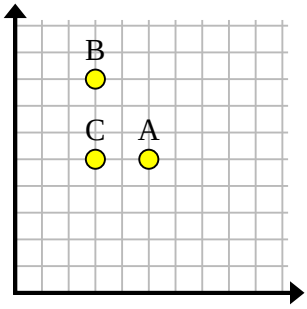


## Respuestas

Ej. (7,7)

1. _____
2. _____
3. _____
4. _____
5. _____
6. _____
7. _____
8. _____
9. _____
10. _____
11. _____



| | | | | | | | | | | |
|---|---|---|---|---|---|---|---|---|---|---|
| 1-10 | 91 | 82 | 73 | 64 | 55 | 45 | 36 | 27 | 18 | 9 |
| 11 | 0 | | | | | | | | | |

**Encuentra las coordenadas del punto D para hacer un rectángulo.**

**Ej)**

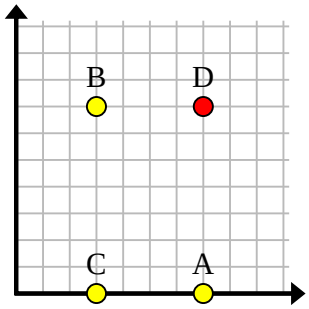


**1)**

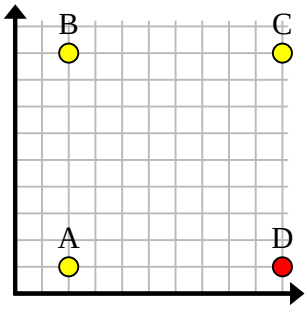


**2)**

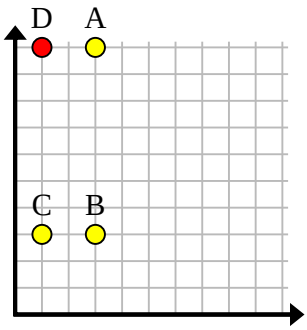


**3)**

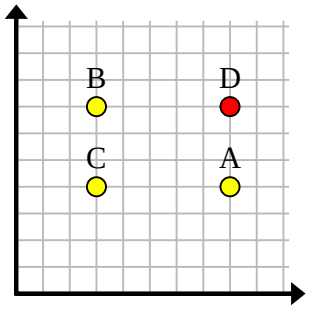


**4)**

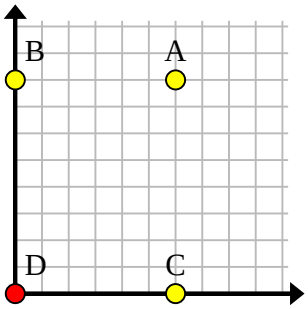


**5)**

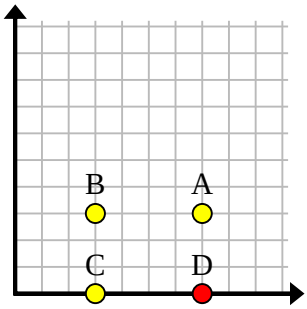


**6)**

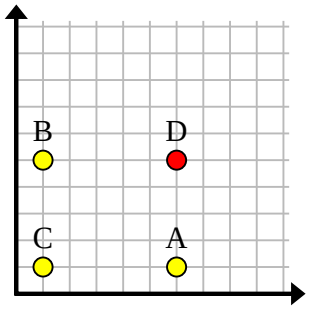


**7)**

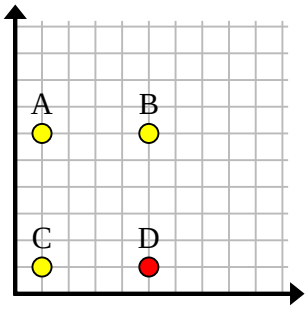


**8)**

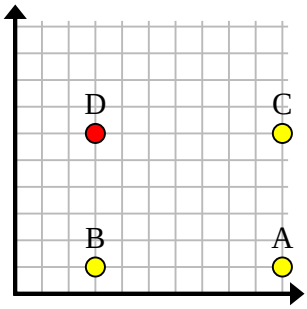


**9)**

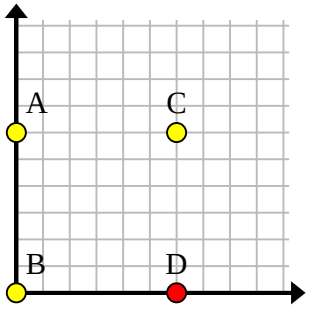


**10)**

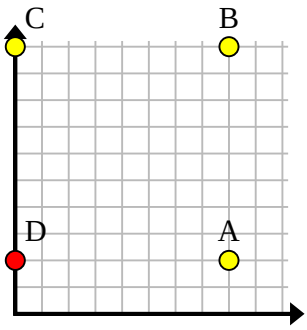


**11)**

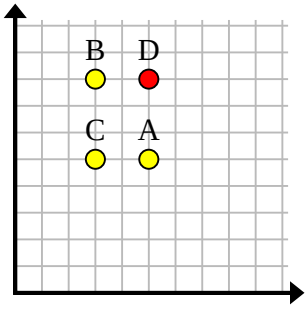


## Respuestas

| | |
|---|---|
| Ej. | ( 7 , 7 ) |
| 1. | ( 10 , 1 ) |
| 2. | ( 1 , 10 ) |
| 3. | ( 8 , 7 ) |
| 4. | ( 0 , 0 ) |
| 5. | ( 7 , 0 ) |
| 6. | ( 6 , 5 ) |
| 7. | ( 5 , 1 ) |
| 8. | ( 3 , 6 ) |
| 9. | ( 6 , 0 ) |
| 10. | ( 0 , 2 ) |
| 11. | ( 5 , 8 ) |



| | | | | | | | | | | |
|---|---|---|---|---|---|---|---|---|---|---|
| 1-10 | 91 | 82 | 73 | 64 | 55 | 45 | 36 | 27 | 18 | 9 |
| 11 | 0 | | | | | | | | | |