Crear rectángulos en una cuadrícula con coordenadas Nombre:

Encuentra las coordenadas del punto D para hacer un rectángulo.

Ej)

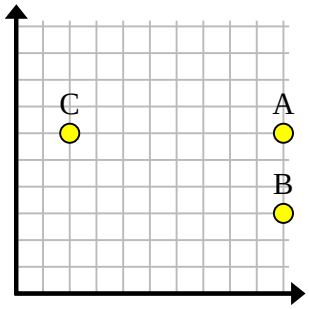

1)

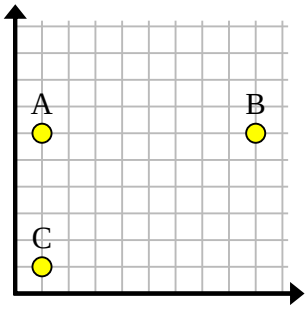

2)

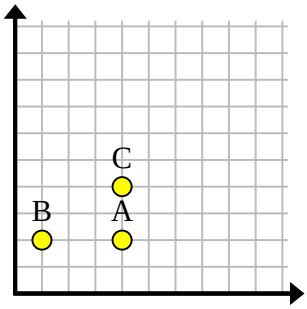

3)

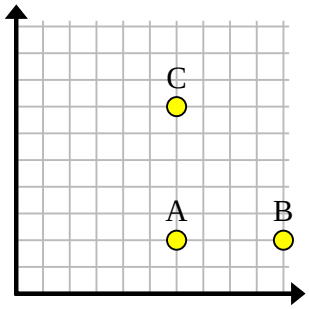

4)

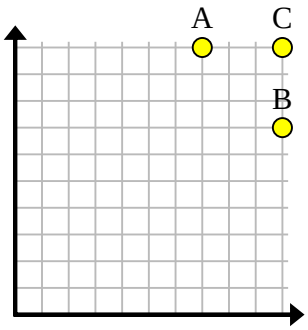

5)

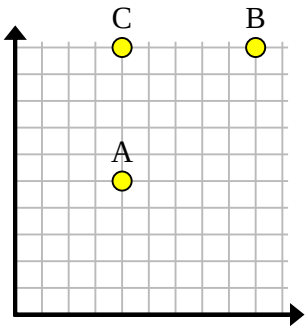

6)

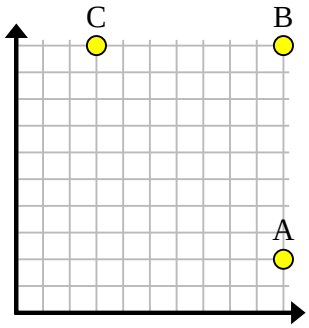

7)

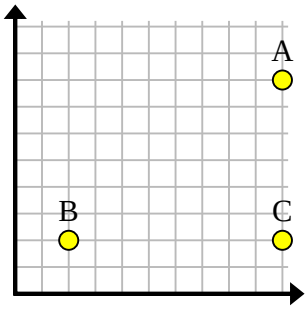

8)

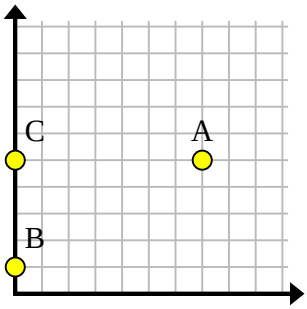

9)

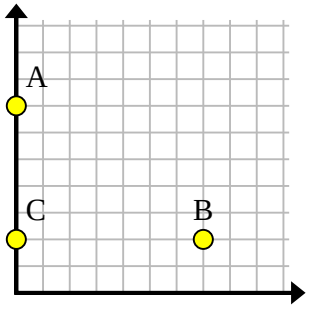

10)

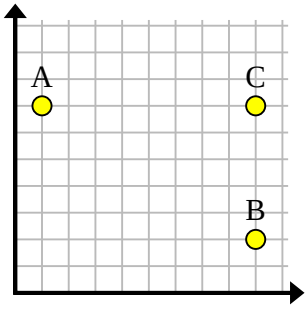

11)

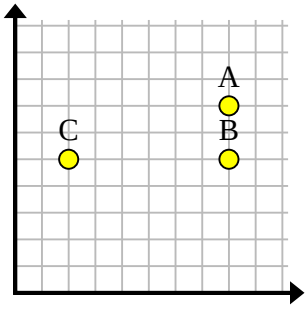

Respuestas

Ej. (2,3)

1. _____
2. _____
3. _____
4. _____
5. _____
6. _____
7. _____
8. _____
9. _____
10. _____
11. _____

1-10	91	82	73	64	55	45	36	27	18	9
11	0									

Crear rectángulos en una cuadrícula con coordenadas Nombre: **Clave De Respuestas**

Encuentra las coordenadas del punto D para hacer un rectángulo.

Ej)

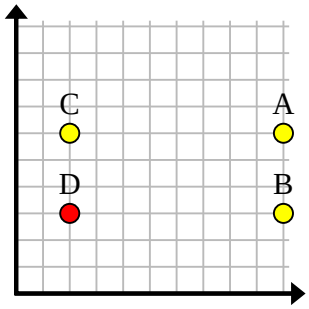

1)

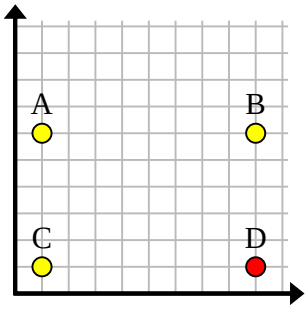

2)

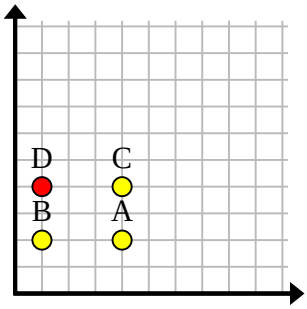

3)

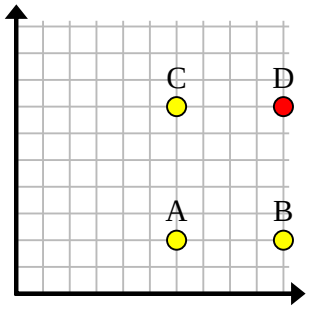

4)

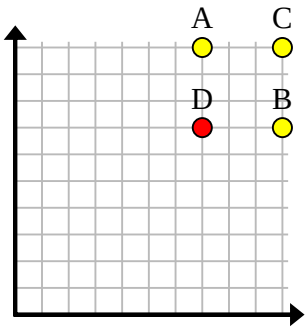

5)

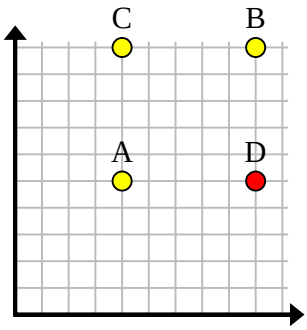

6)

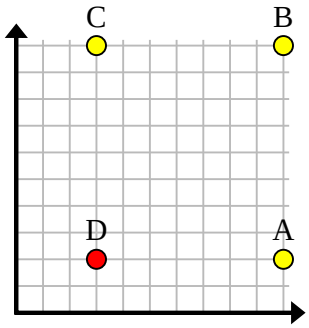

7)

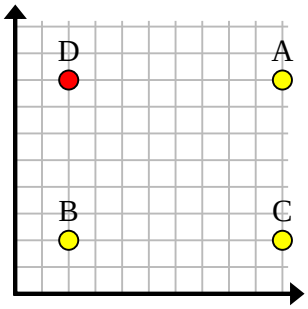

8)

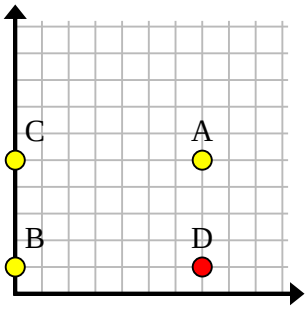

9)

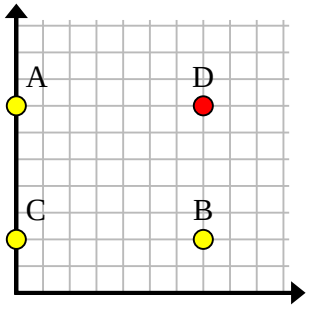

10)

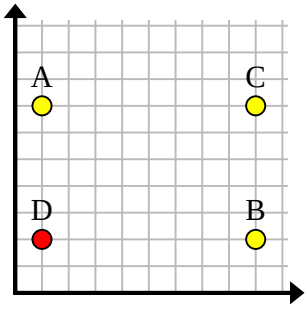

11)

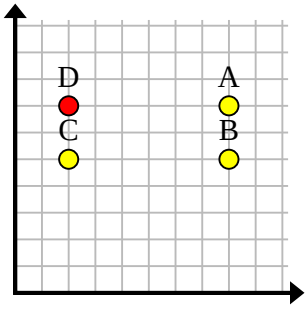

Respuestas

Ej.	(2 , 3)
1.	(9 , 1)
2.	(1 , 4)
3.	(10 , 7)
4.	(7 , 7)
5.	(9 , 5)
6.	(3 , 2)
7.	(2 , 8)
8.	(7 , 1)
9.	(7 , 7)
10.	(1 , 2)
11.	(2 , 7)

1-10	91	82	73	64	55	45	36	27	18	9
11	0									