Crear rectángulos en una cuadrícula con coordenadas Nombre:

Encuentra las coordenadas del punto D para hacer un rectángulo.

Ej)

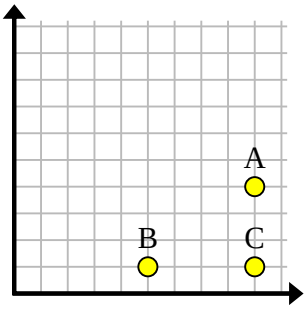

1)

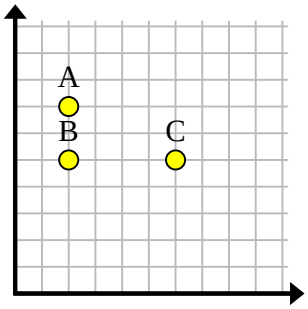

2)

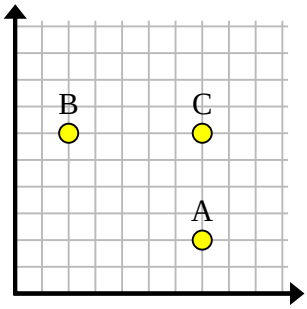

3)

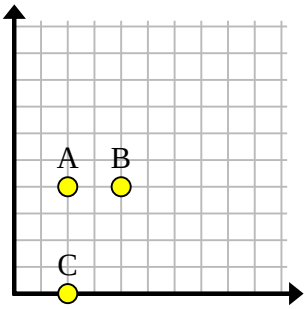

4)

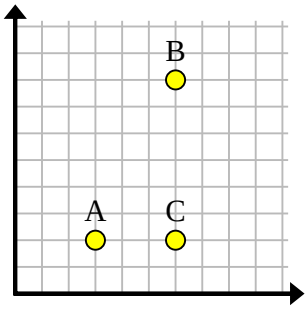

5)

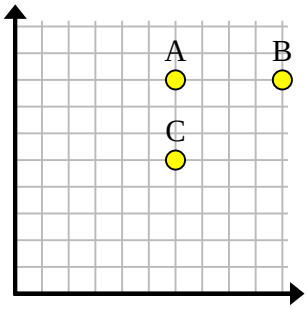

6)

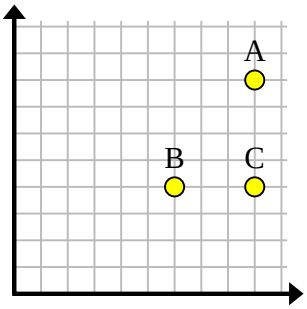

7)

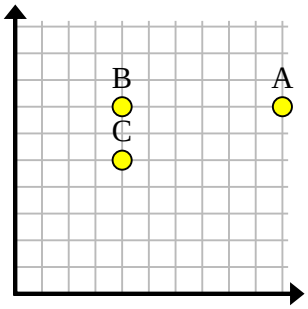

8)

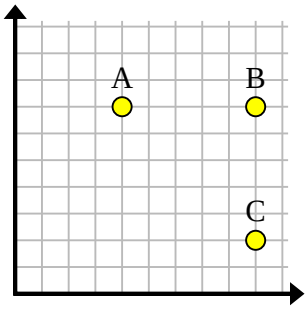

9)

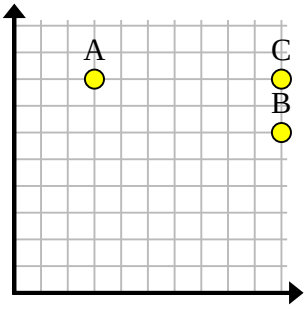

10)

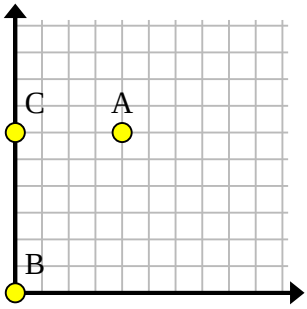

11)

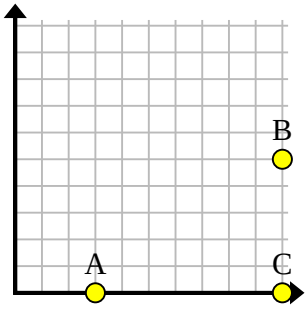

Respuestas

Ej. (5,4)

1. _____
2. _____
3. _____
4. _____
5. _____
6. _____
7. _____
8. _____
9. _____
10. _____
11. _____

Crear rectángulos en una cuadrícula con coordenadas Nombre: **Clave De Respuestas**

Encuentra las coordenadas del punto D para hacer un rectángulo.

Ej)

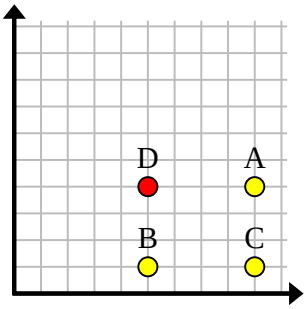

1)

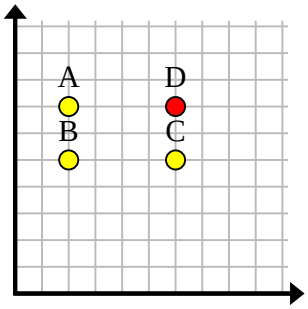

2)

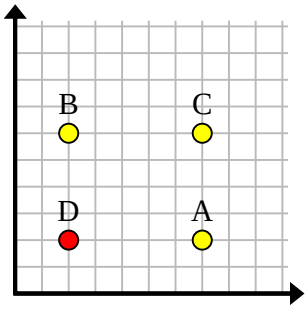

3)

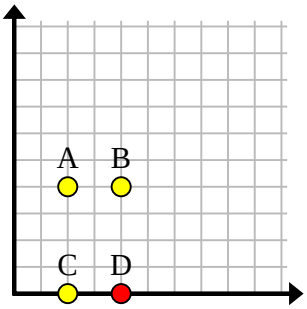

4)

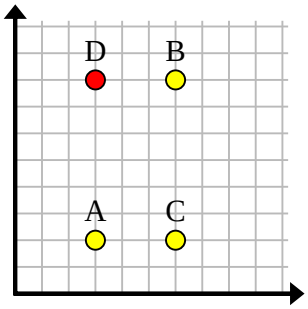

5)

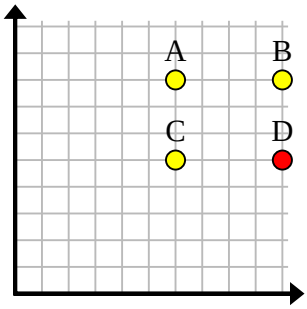

6)

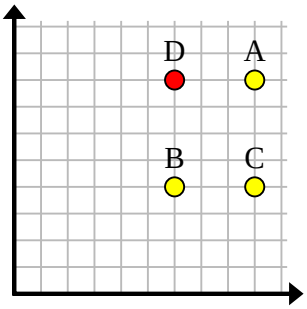

7)

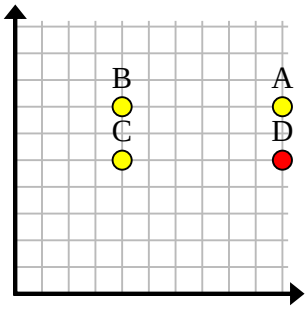

8)

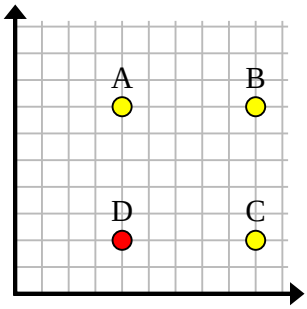

9)

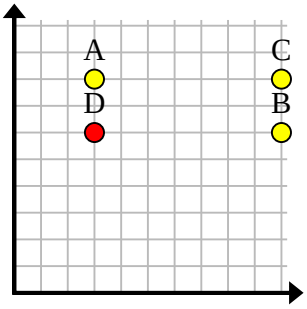

10)

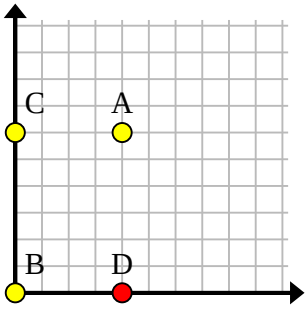

11)

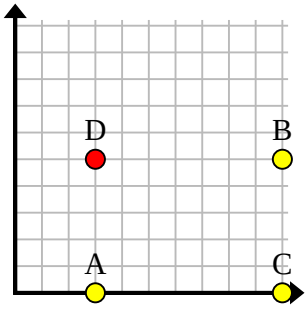

Respuestas

Ej.	(5 , 4)
1.	(6 , 7)
2.	(2 , 2)
3.	(4 , 0)
4.	(3 , 8)
5.	(10 , 5)
6.	(6 , 8)
7.	(10 , 5)
8.	(4 , 2)
9.	(3 , 6)
10.	(4 , 0)
11.	(3 , 5)