Encontrando la distancia en un plano cartesiano Nombre:

Encuentra la distancia entre puntos.

Ej)

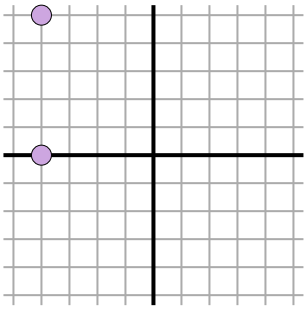

1)

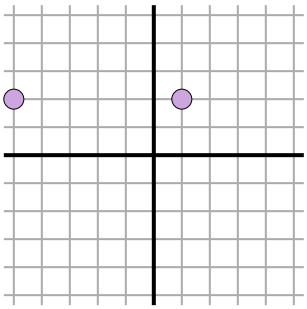

2)

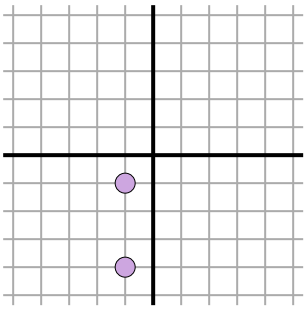

3)

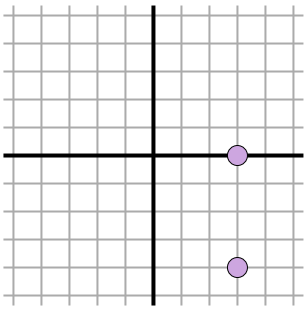

4)

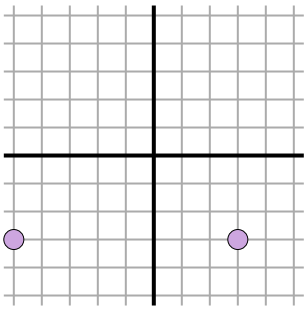

5)

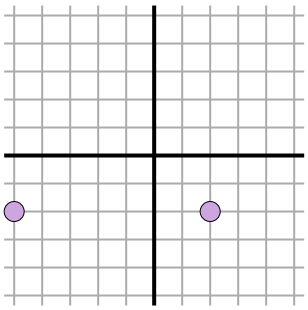

6)

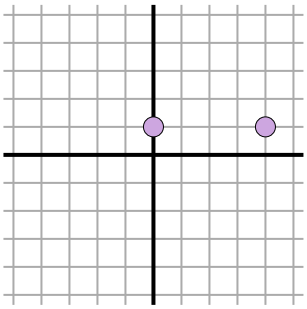

7)

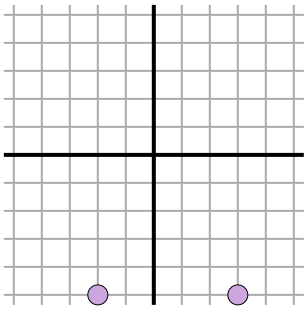

8)

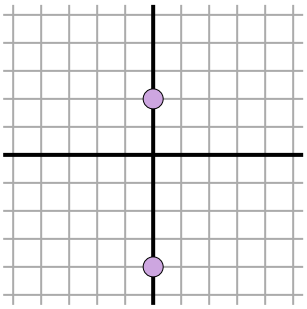

9)

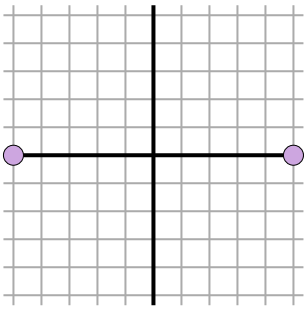

10)

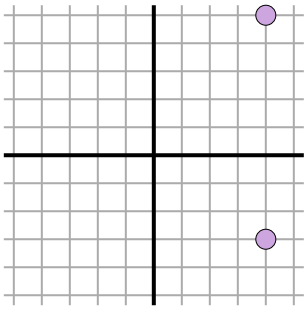

11)

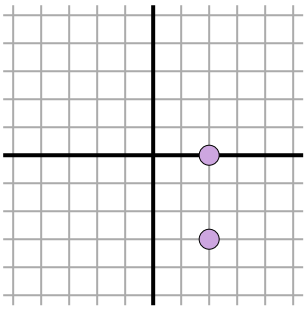

Respuestas

Ej. 5

1. _____
2. _____
3. _____
4. _____
5. _____
6. _____
7. _____
8. _____
9. _____
10. _____
11. _____

1-10	91	82	73	64	55	45	36	27	18	9
11	0									

Encuentra la distancia entre puntos.

Ej)

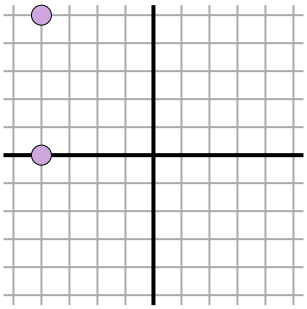

$\sqrt{(-4--4)^2 + (5-0)^2}$

$\sqrt{(0) + (25)}$

1)

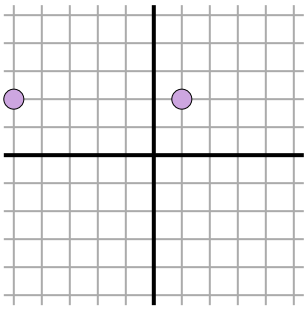

$\sqrt{(-5-1)^2 + (2-2)^2}$

$\sqrt{(36) + (0)}$

2)

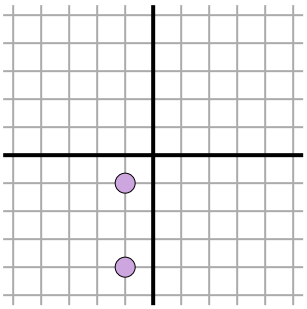

$\sqrt{(-1--1)^2 + (-1--4)^2}$

$\sqrt{(0) + (9)}$

3)

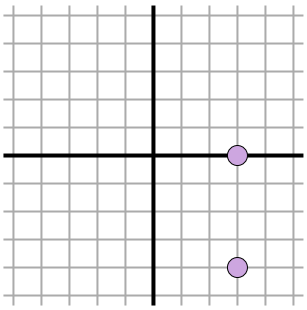

$\sqrt{(3-3)^2 + (0--4)^2}$

$\sqrt{(0) + (16)}$

4)

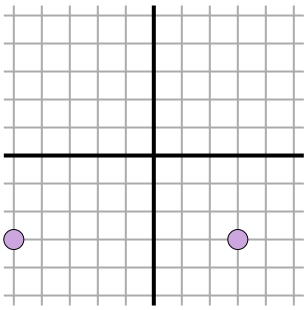

$\sqrt{(-5-3)^2 + (-3--3)^2}$

$\sqrt{(64) + (0)}$

5)

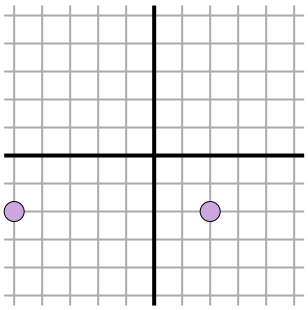

$\sqrt{(2--5)^2 + (-2--2)^2}$

$\sqrt{(49) + (0)}$

6)

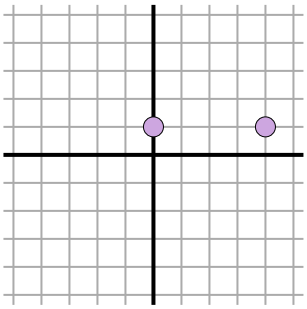

$\sqrt{(0-4)^2 + (1-1)^2}$

$\sqrt{(16) + (0)}$

7)

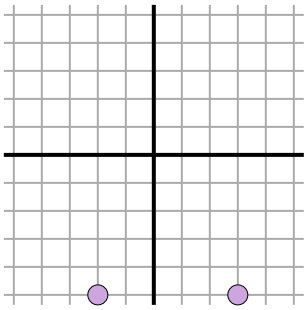

$\sqrt{(3--2)^2 + (-5--5)^2}$

$\sqrt{(25) + (0)}$

8)

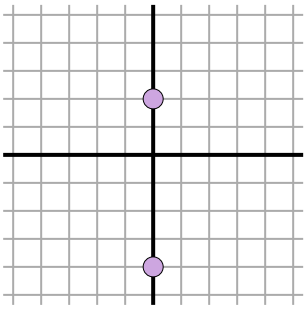

$\sqrt{(0-0)^2 + (2--4)^2}$

$\sqrt{(0) + (36)}$

9)

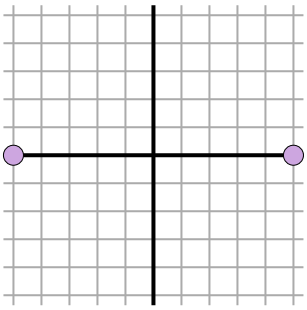

$\sqrt{(5--5)^2 + (0-0)^2}$

$\sqrt{(100) + (0)}$

10)

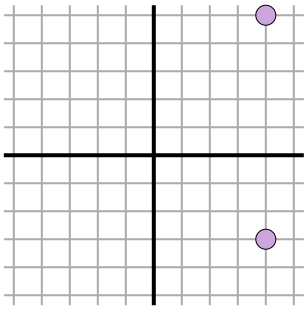

$\sqrt{(4-4)^2 + (-3-5)^2}$

$\sqrt{(0) + (64)}$

11)

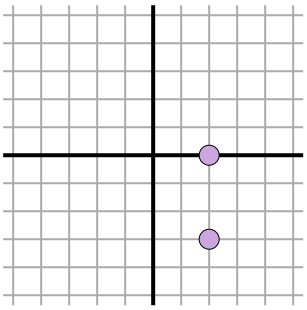

$\sqrt{(2-2)^2 + (0--3)^2}$

$\sqrt{(0) + (9)}$

Respuestas

Ej.	5
1.	6
2.	3
3.	4
4.	8
5.	7
6.	4
7.	5
8.	6
9.	10
10.	8
11.	3

1-10	91	82	73	64	55	45	36	27	18	9
11	0									