Re-escribiendo problemas de multiplicación (Visual)

Nombre:

Escribir cada matriz como un problema de multiplicación y resolver.

Ej)



1)



2)

3)

4)



5)



6)



7)

8)



9)

10)

11)



Respuestas

Ej. **7 × 9 = 63**

1. _____
2. _____
3. _____
4. _____
5. _____
6. _____
7. _____
8. _____
9. _____
10. _____
11. _____

1-10	91	82	73	64	55	45	36	27	18	9
11	0									

Re-escribiendo problemas de multiplicación (Visual)

Nombre: **Clave De Respuestas**

Escribir cada matriz como un problema de multiplicación y resolver.

Ej)



1)



2)

3)

4)



5)



6)



7)

8)



9)

10)

11)



Respuestas

Ej. **7 × 9 = 63**

1. **9 × 3 = 27**
2. **6 × 2 = 12**
3. **9 × 4 = 36**
4. **6 × 5 = 30**
5. **9 × 7 = 63**
6. **6 × 10 = 60**
7. **7 × 6 = 42**
8. **4 × 10 = 40**
9. **5 × 6 = 30**
10. **2 × 3 = 6**
11. **6 × 6 = 36**

1-10	91	82	73	64	55	45	36	27	18	9
11	0									