Re-escribiendo problemas de multiplicación (Visual)

Nombre:

Escribir cada matriz como un problema de multiplicación y resolver.

Ej)

1)



2)

3)

4)

5)



6)

7)

8)

9)



10)

11)



Respuestas

Ej. **6 × 3 = 18**

1. _____
2. _____
3. _____
4. _____
5. _____
6. _____
7. _____
8. _____
9. _____
10. _____
11. _____

1-10	91	82	73	64	55	45	36	27	18	9
11	0									

Re-escribiendo problemas de multiplicación (Visual)

Nombre: **Clave De Respuestas**

Escribir cada matriz como un problema de multiplicación y resolver.

Ej)

1)



2)

3)

4)

5)



6)

7)

8)

9)



10)

11)



Respuestas

Ej. **6 × 3 = 18**

1. **10 × 9 = 90**
2. **9 × 5 = 45**
3. **5 × 2 = 10**
4. **8 × 4 = 32**
5. **9 × 10 = 90**
6. **3 × 2 = 6**
7. **4 × 9 = 36**
8. **10 × 3 = 30**
9. **10 × 7 = 70**
10. **2 × 8 = 16**
11. **3 × 4 = 12**

1-10	91	82	73	64	55	45	36	27	18	9
11	0									