Re-escribiendo problemas de multiplicación (Visual)

Nombre:

Escribir cada matriz como un problema de multiplicación y resolver.

Ej)



1)

2)

3)



4)

5)

6)

7)

8)



9)

10)



11)

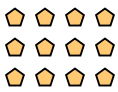

Respuestas

Ej. **8 × 5 = 40**

1. _____
2. _____
3. _____
4. _____
5. _____
6. _____
7. _____
8. _____
9. _____
10. _____
11. _____

1-10	91	82	73	64	55	45	36	27	18	9
11	0									

Re-escribiendo problemas de multiplicación (Visual) Nombre: **Clave De Respuestas**

Escribir cada matriz como un problema de multiplicación y resolver.

Ej)



1)

2)

3)



4)

5)

6)

7)

8)



9)

10)



11)

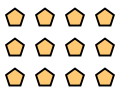

Respuestas

Ej. **8 × 5 = 40**

1. **9 × 3 = 27**
2. **4 × 5 = 20**
3. **5 × 8 = 40**
4. **10 × 2 = 20**
5. **5 × 6 = 30**
6. **9 × 5 = 45**
7. **8 × 2 = 16**
8. **7 × 8 = 56**
9. **2 × 4 = 8**
10. **10 × 4 = 40**
11. **3 × 4 = 12**

1-10	91	82	73	64	55	45	36	27	18	9
11	0									