Máquinas de Funciones - (Sumar y Restar) Nombre:

**Determina la regla que cada máquina de función está usando.**

**Ej)**

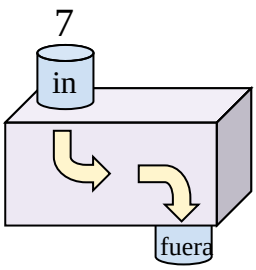


Agregar 25

**1)**

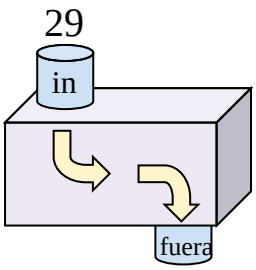


**2)**

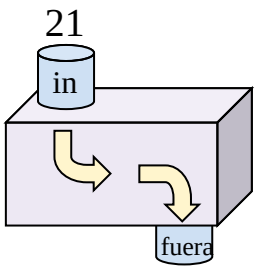


**3)**

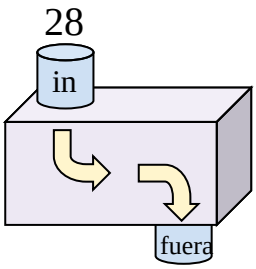


**4)**

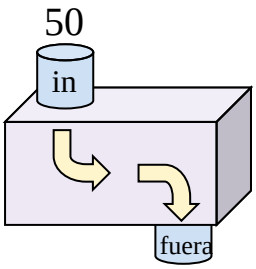


**5)**

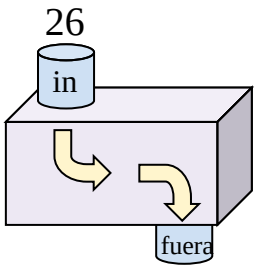


**6)**

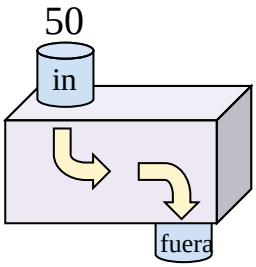


**7)**

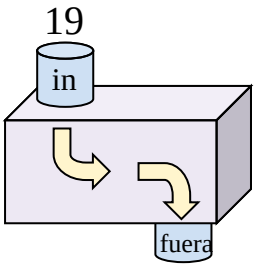


**8)**

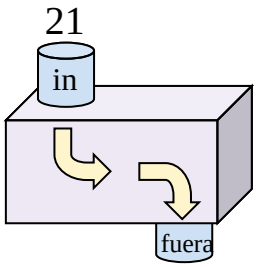


**9)**

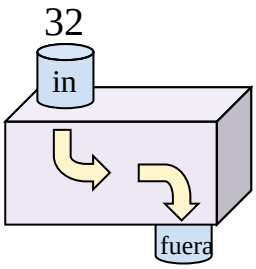


**10)**

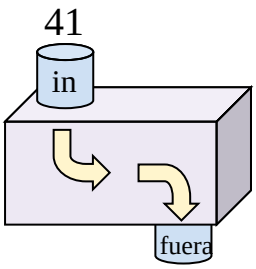


**11)**

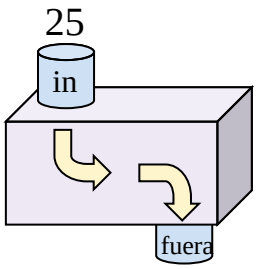


## Respuestas

Ej. Agregar 25

1. _____
2. _____
3. _____
4. _____
5. _____
6. _____
7. _____
8. _____
9. _____
10. _____
11. _____

Máquinas de Funciones - (Sumar y Restar) Nombre: **Clave De Respuestas**

**Determina la regla que cada máquina de función está usando.**

**Ej)**

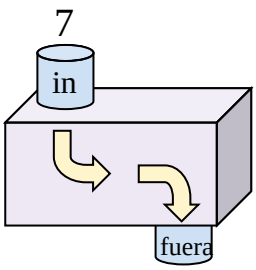


Agregar 25

**1)**

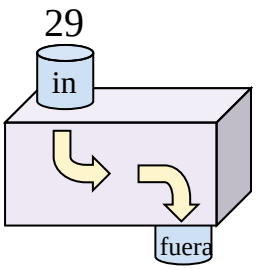


Restar 7

**2)**

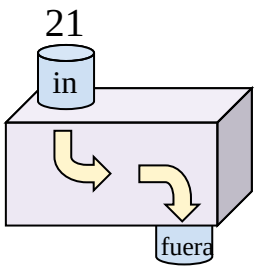


Agregar 8

**3)**

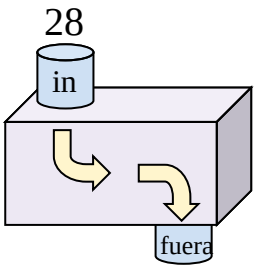


Agregar 9

**4)**

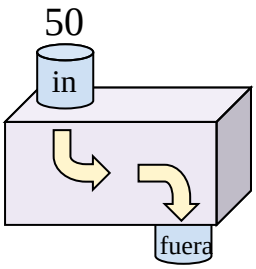


Restar 38

**5)**

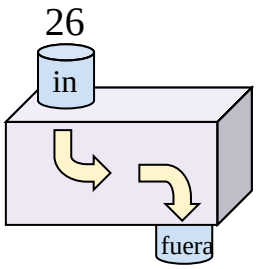


Restar 17

**6)**

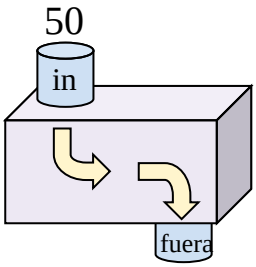


Restar 27

**7)**

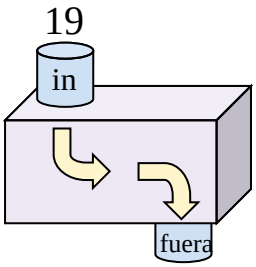


Agregar 20

**8)**

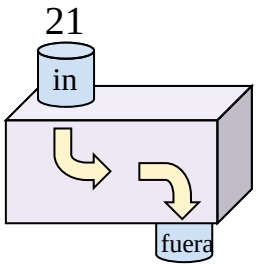


Agregar 7

**9)**

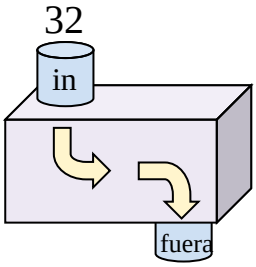


Restar 14

**10)**

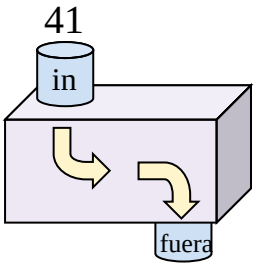


Restar 12

**11)**

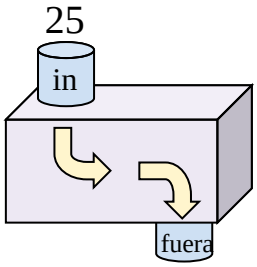


Agregar 8

## Respuestas

Ej. **Agregar 25**

1. **Restar 7**
2. **Agregar 8**
3. **Agregar 9**
4. **Restar 38**
5. **Restar 17**
6. **Restar 27**
7. **Agregar 20**
8. **Agregar 7**
9. **Restar 14**
10. **Restar 12**
11. **Agregar 8**